Function Machines (Add & Subtract) Name:

Determine the rule each function machine is using.

Ex)

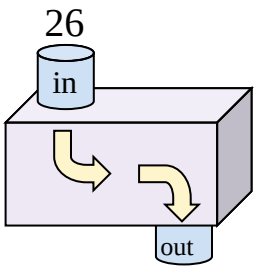

Add 17

1)

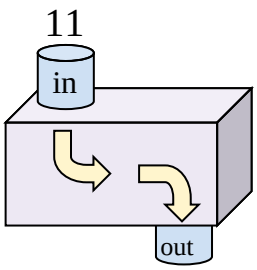

2)

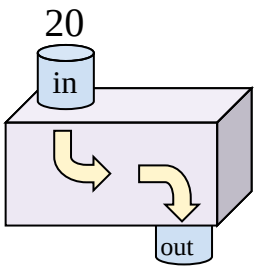

3)

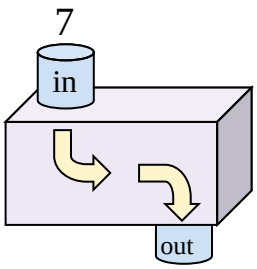

4)

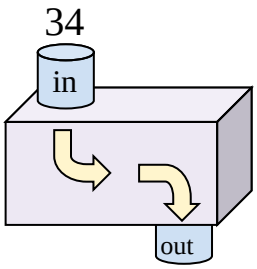

5)

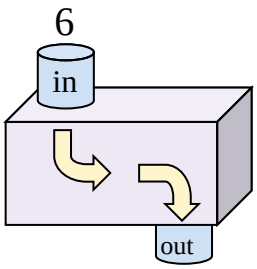

6)

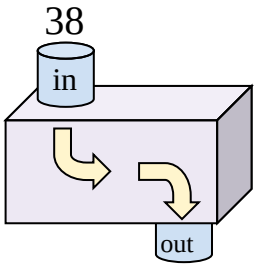

7)

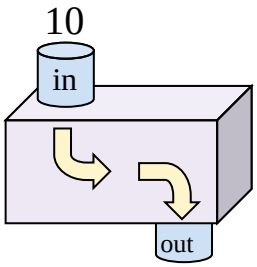

8)

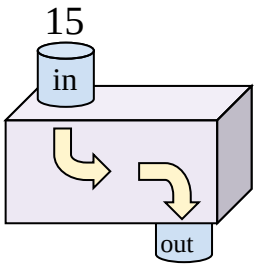

9)

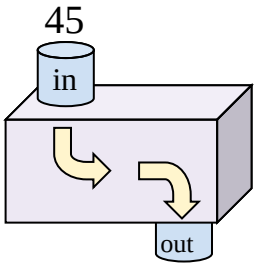

10)

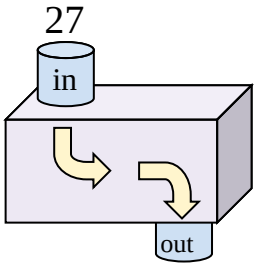

11)

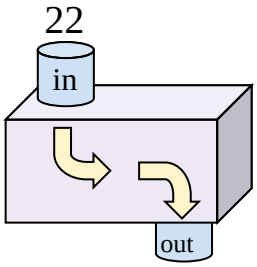

Answers

Ex. Add 17

1. _____
2. _____
3. _____
4. _____
5. _____
6. _____
7. _____
8. _____
9. _____
10. _____
11. _____

Function Machines (Add & Subtract) Name: **Answer Key**

Determine the rule each function machine is using.

Ex)

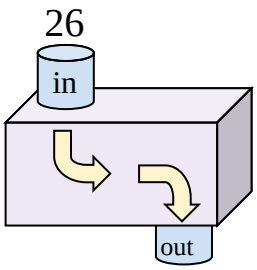

Add 17

1)

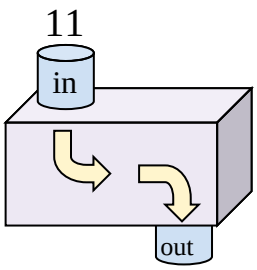

Add 18

2)

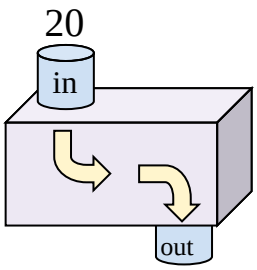

Subtract 5

3)

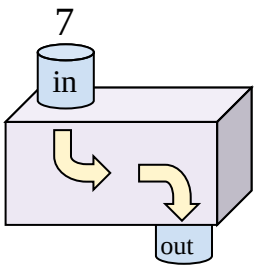

Add 24

4)

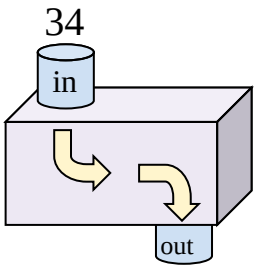

Subtract 15

5)

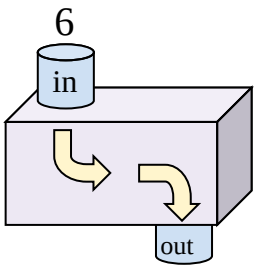

Add 5

6)

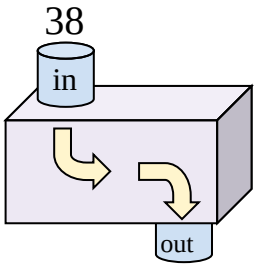

Subtract 11

7)

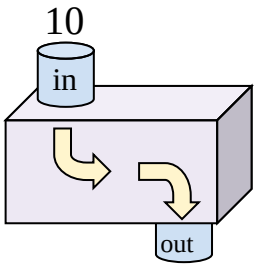

Add 18

8)

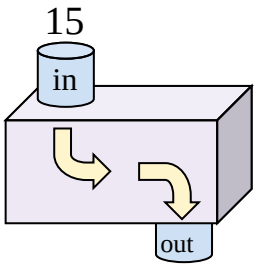

Add 34

9)

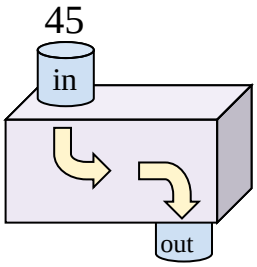

Subtract 29

10)

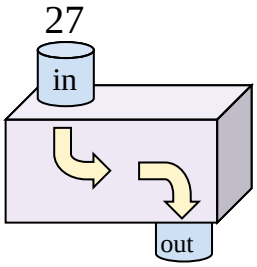

Subtract 17

11)

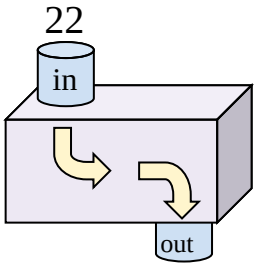

Add 8

Answers

Ex.	Add 17
1.	Add 18
2.	Subtract 5
3.	Add 24
4.	Subtract 15
5.	Add 5
6.	Subtract 11
7.	Add 18
8.	Add 34
9.	Subtract 29
10.	Subtract 17
11.	Add 8