# Rewriting Multiplication Problems (visual)

Name:

**Write each array as a multiplication problem and solve.**

**Ex)**

**1)**

**2)**



**3)**

**4)**



**5)**

**6)**

**7)**

**8)**

**9)**

**10)**

**11)**

## Answers

Ex. **5 × 8 = 40**

1. _____
2. _____
3. _____
4. _____
5. _____
6. _____
7. _____
8. _____
9. _____
10. _____
11. _____



| | | | | | | | | | | |
|---|---|---|---|---|---|---|---|---|---|---|
| 1-10 | 91 | 82 | 73 | 64 | 55 | 45 | 36 | 27 | 18 | 9 |
| 11 | 0 | | | | | | | | | |

Rewriting Multiplication Problems (visual) Name: **Answer Key**

**Write each array as a multiplication problem and solve.**

**Ex)**

**1)**

**2)** 

**3)**

**4)** 

**5)**

**6)**

**7)**

**8)**

**9)**

**10)**

**11)** 

## Answers

| | |
|---|---|
| Ex. | 5 × 8 = 40 |
| 1. | 10 × 5 = 50 |
| 2. | 4 × 5 = 20 |
| 3. | 2 × 8 = 16 |
| 4. | 3 × 9 = 27 |
| 5. | 7 × 2 = 14 |
| 6. | 4 × 4 = 16 |
| 7. | 2 × 2 = 4 |
| 8. | 8 × 2 = 16 |
| 9. | 7 × 3 = 21 |
| 10. | 4 × 2 = 8 |
| 11. | 10 × 2 = 20 |



| | | | | | | | | | | |
|---|---|---|---|---|---|---|---|---|---|---|
| 1-10 | 91 | 82 | 73 | 64 | 55 | 45 | 36 | 27 | 18 | 9 |
| 11 | 0 | | | | | | | | | |