# Finding Distance on a Grid

Name:

**Find the distance between points.**

Ex)

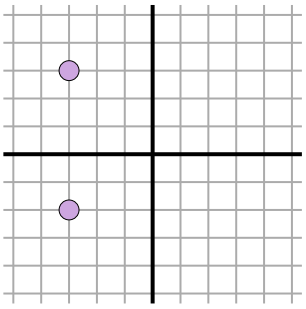

1)

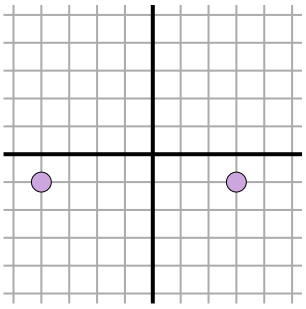

2)

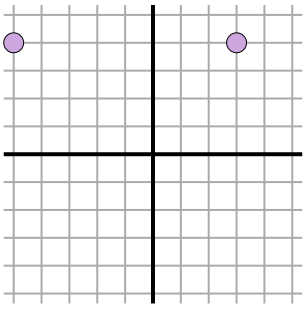

3)

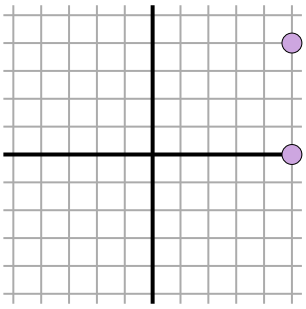

4)

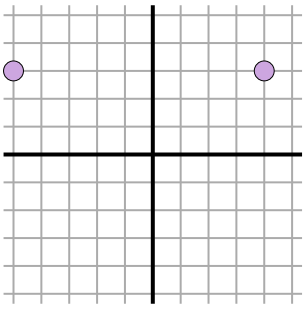

5)

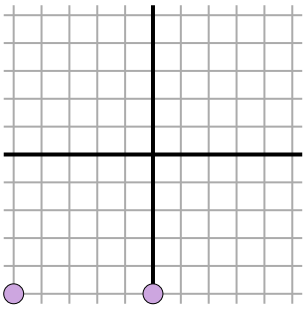

6)

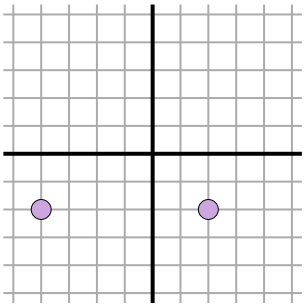

7)

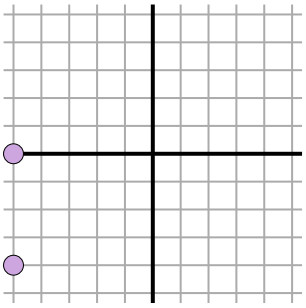

8)

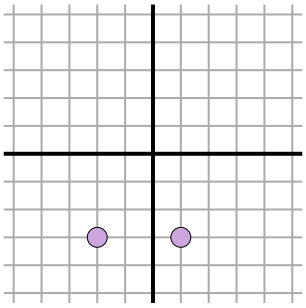

9)

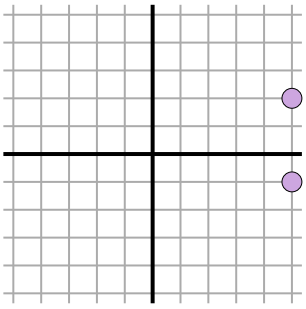

10)

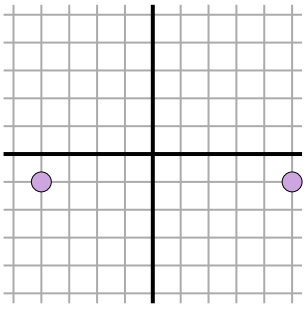

11)

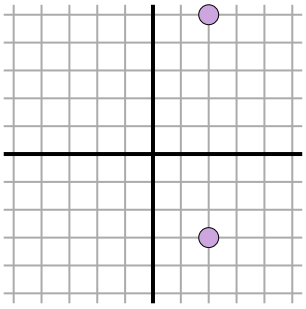

## Answers

Ex. 5

1. _____
2. _____
3. _____
4. _____
5. _____
6. _____
7. _____
8. _____
9. _____
10. _____
11. _____



| | | | | | | | | | | |
|---|---|---|---|---|---|---|---|---|---|---|
| 1-10 | 91 | 82 | 73 | 64 | 55 | 45 | 36 | 27 | 18 | 9 |
| 11 | 0 | | | | | | | | | |

Finding Distance on a Grid

Name: **Answer Key**

**Find the distance between points.**

**Ex)**

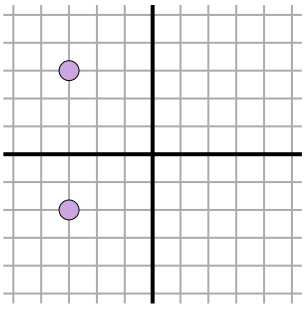

$\sqrt{(-3--3)^2 + (-2-3)^2}$

$\sqrt{(0) + (25)}$

**1)**

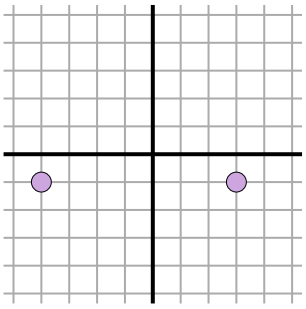

$\sqrt{(3--4)^2 + (-1--1)^2}$

$\sqrt{(49) + (0)}$

**2)**

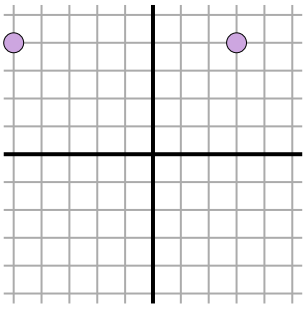

$\sqrt{(3--5)^2 + (4-4)^2}$

$\sqrt{(64) + (0)}$

**3)**

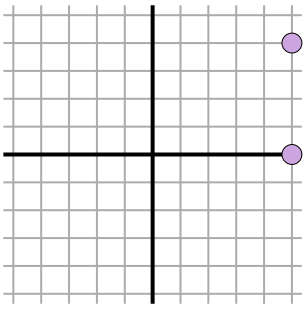

$\sqrt{(5-5)^2 + (0-4)^2}$

$\sqrt{(0) + (16)}$

**4)**

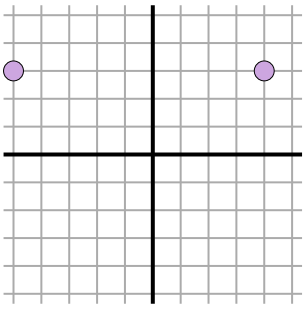

$\sqrt{(4--5)^2 + (3-3)^2}$

$\sqrt{(81) + (0)}$

**5)**

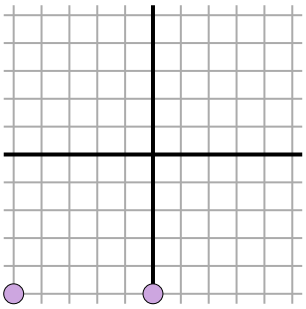

$\sqrt{(-5-0)^2 + (-5--5)^2}$

$\sqrt{(25) + (0)}$

**6)**

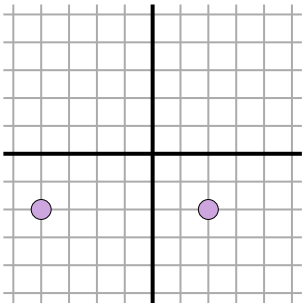

$\sqrt{(-4-2)^2 + (-2--2)^2}$

$\sqrt{(36) + (0)}$

**7)**

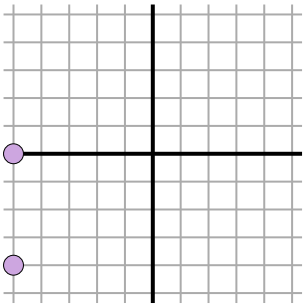

$\sqrt{(-5--5)^2 + (0--4)^2}$

$\sqrt{(0) + (16)}$

**8)**

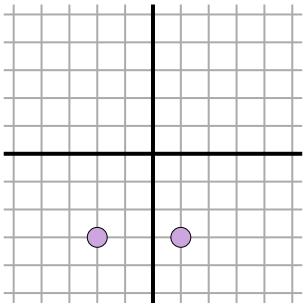

$\sqrt{(1--2)^2 + (-3--3)^2}$

$\sqrt{(9) + (0)}$

**9)**

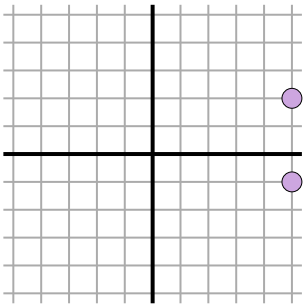

$\sqrt{(5-5)^2 + (2--1)^2}$

$\sqrt{(0) + (9)}$

**10)**

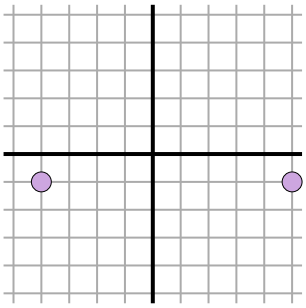

$\sqrt{(-4-5)^2 + (-1--1)^2}$

$\sqrt{(81) + (0)}$

**11)**

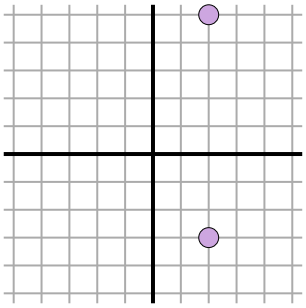

$\sqrt{(2-2)^2 + (-3-5)^2}$

$\sqrt{(0) + (64)}$

## Answers

| | |
|---|---|
| Ex. | 5 |
| 1. | 7 |
| 2. | 8 |
| 3. | 4 |
| 4. | 9 |
| 5. | 5 |
| 6. | 6 |
| 7. | 4 |
| 8. | 3 |
| 9. | 3 |
| 10. | 9 |
| 11. | 8 |