# Improper and Mixed Fractions Visual

Name:

**Write each amount as a mixed number.**

**1)**

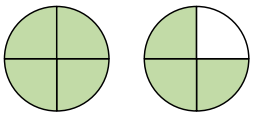

**2)**

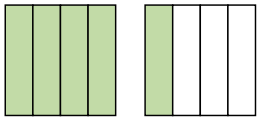

**3)**

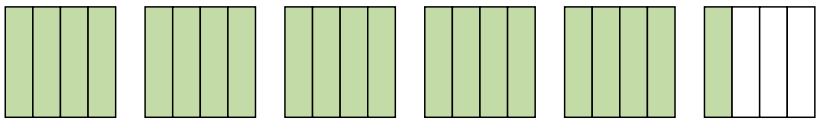

**4)**



**5)**

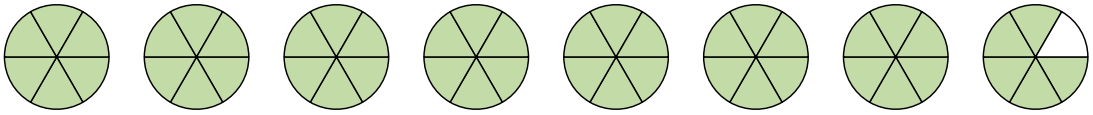

**Write each amount as an improper fraction.**

**6)**

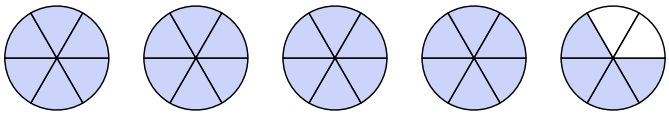

**7)**

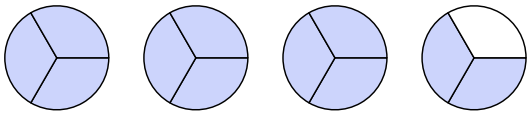

**8)**

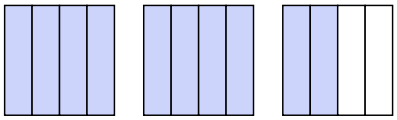

**9)**

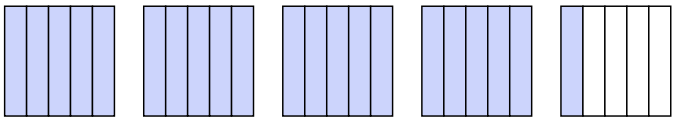

**10)**

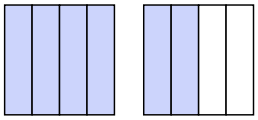

**11)**

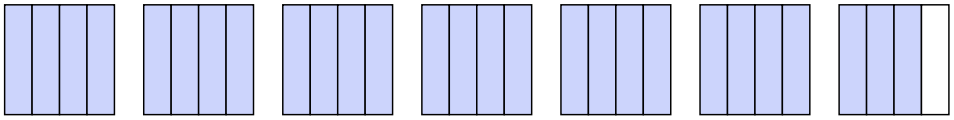

## Answers

1. _____
2. _____
3. _____
4. _____
5. _____
6. _____
7. _____
8. _____
9. _____
10. _____
11. _____



| | | | | | | | | | | |
|---|---|---|---|---|---|---|---|---|---|---|
| 1-10 | 91 | 82 | 73 | 64 | 55 | 45 | 36 | 27 | 18 | 9 |
| 11 | 0 | | | | | | | | | |

Improper and Mixed Fractions Visual

Name: **Answer Key**

**Write each amount as a mixed number.**

1) 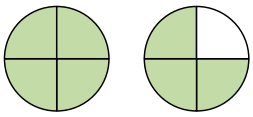

2) 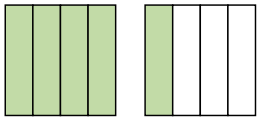

3) 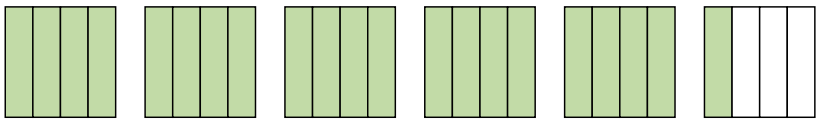

4) 

5) 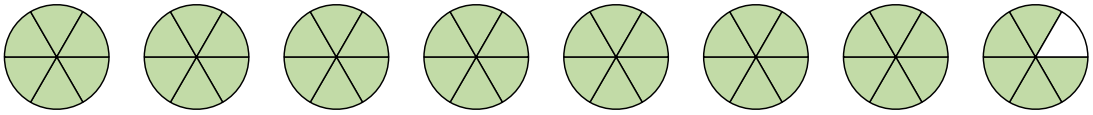

**Write each amount as an improper fraction.**

6) 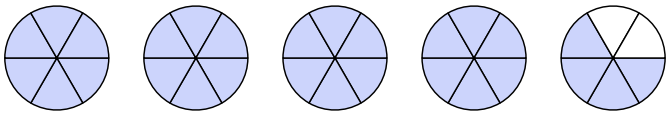

7) 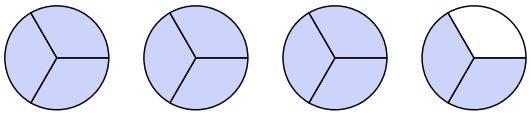

8) 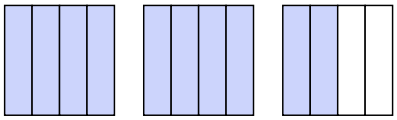

9) 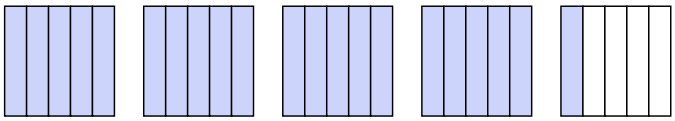

10) 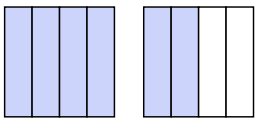

11) 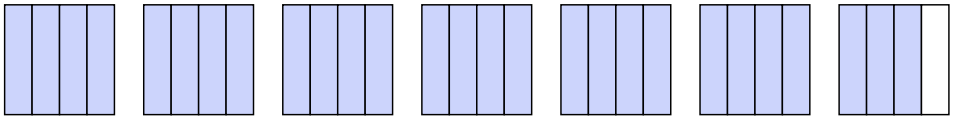

**Answers**

1. $1\frac{3}{4}$
2. $1\frac{1}{4}$
3. $5\frac{1}{4}$
4. $6\frac{1}{3}$
5. $7\frac{5}{6}$
6. $\frac{28}{6}$
7. $\frac{11}{3}$
8. $\frac{10}{4}$
9. $\frac{21}{5}$
10. $\frac{6}{4}$
11. $\frac{27}{4}$



| | | | | | | | | | | |
|---|---|---|---|---|---|---|---|---|---|---|
| 1-10 | 91 | 82 | 73 | 64 | 55 | 45 | 36 | 27 | 18 | 9 |
| 11 | 0 | | | | | | | | | |