Fraction Quantity Relative to Whole

Name:

Solve each problem.

Ex) Express the stars as a fraction of the entire set.



1) Express the pentagons as a fraction of the entire set.

2) Express the hearts as a fraction of the entire set.

3) Express the pentagons as a fraction of the entire set.

4) Express the stars as a fraction of the entire set.

5) Express the circles as a fraction of the entire set.

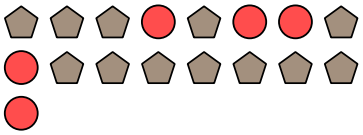

6) Express the pentagons as a fraction of the entire set.



7) Express the triangles as a fraction of the entire set.

8) Express the squares as a fraction of the entire set.

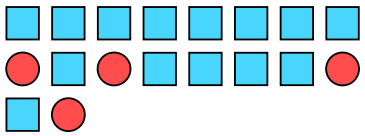

9) Express the stars as a fraction of the entire set.

10) Express the moons as a fraction of the entire set.

11) Express the moons as a fraction of the entire set.

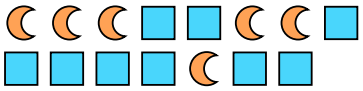

Answers

Ex. 15/25

1. _____
2. _____
3. _____
4. _____
5. _____
6. _____
7. _____
8. _____
9. _____
10. _____
11. _____

1-10	91	82	73	64	55	45	36	27	18	9
11	0									

Fraction Quantity Relative to Whole

Name: **Answer Key**

Solve each problem.

Ex) Express the stars as a fraction of the entire set.



1) Express the pentagons as a fraction of the entire set.

2) Express the hearts as a fraction of the entire set.

3) Express the pentagons as a fraction of the entire set.

4) Express the stars as a fraction of the entire set.

5) Express the circles as a fraction of the entire set.

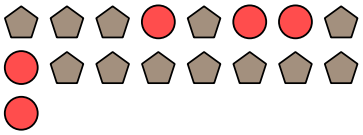

6) Express the pentagons as a fraction of the entire set.



7) Express the triangles as a fraction of the entire set.

8) Express the squares as a fraction of the entire set.

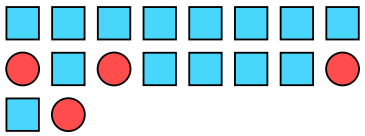

9) Express the stars as a fraction of the entire set.

10) Express the moons as a fraction of the entire set.

11) Express the moons as a fraction of the entire set.

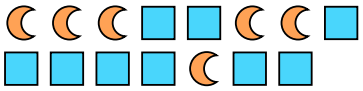

Answers

Ex.	15/25
1.	8/20
2.	10/12
3.	11/16
4.	3/13
5.	5/17
6.	14/29
7.	8/14
8.	14/18
9.	7/12
10.	8/13
11.	6/15

1-10	91	82	73	64	55	45	36	27	18	9
11	0									