Dividing with a Numberline

Name:

Use the numberline to solve each problem.

1) 20÷5=

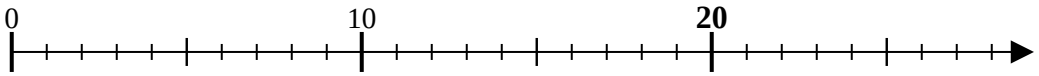

2) 50÷10=

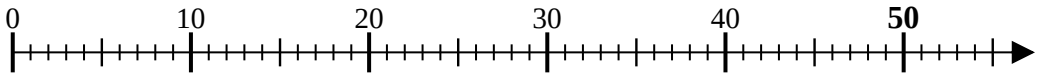

3) 30÷10=

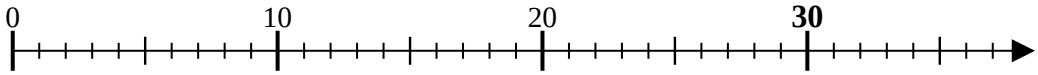

4) 4÷2=

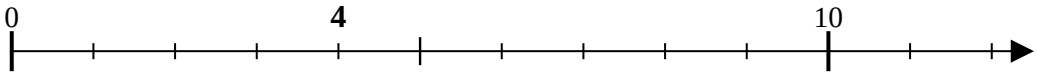

5) 27÷9=

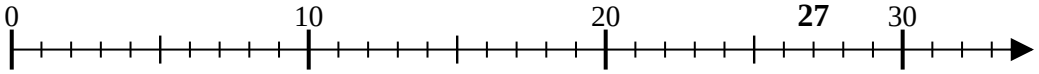

6) 9÷3=

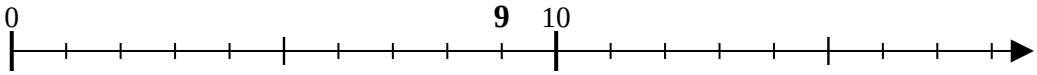

7) 15÷5=

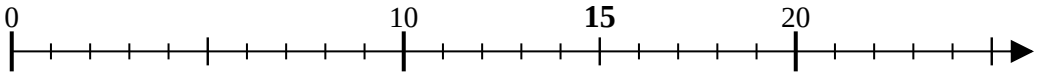

8) 16÷8=

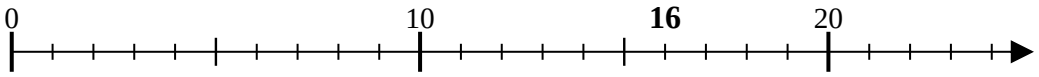

9) 24÷8=

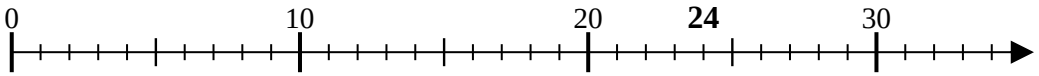

10) 12÷4=

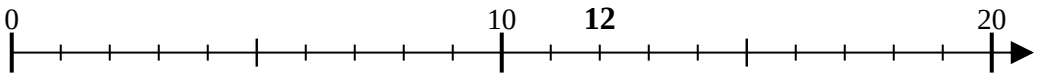

11) 32÷8=

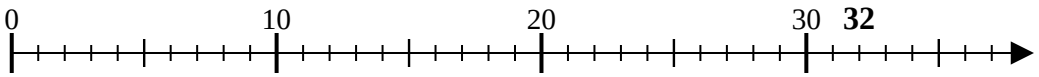

Answers

1. _____
2. _____
3. _____
4. _____
5. _____
6. _____
7. _____
8. _____
9. _____
10. _____
11. _____

1-10	91	82	73	64	55	45	36	27	18	9
11	0									

Dividing with a Numberline

Name: **Answer Key**

Use the numberline to solve each problem.

1) 20÷5=

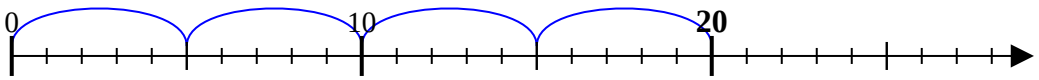

2) 50÷10=

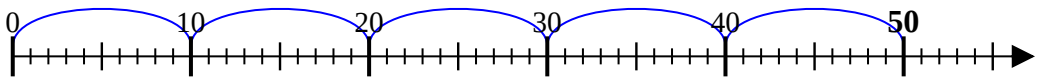

3) 30÷10=

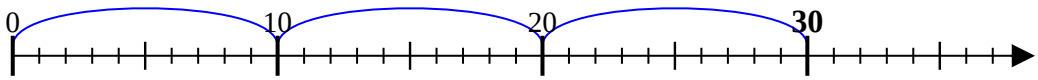

4) 4÷2=

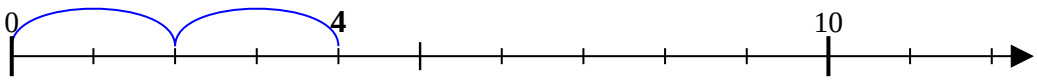

5) 27÷9=

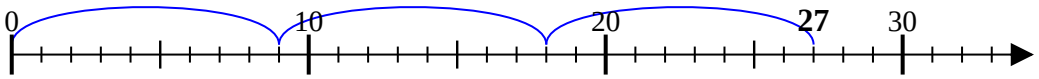

6) 9÷3=

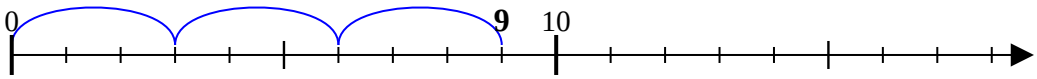

7) 15÷5=

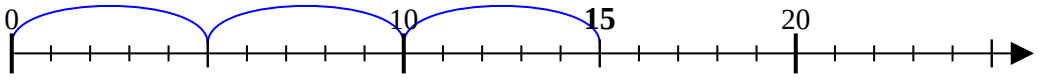

8) 16÷8=

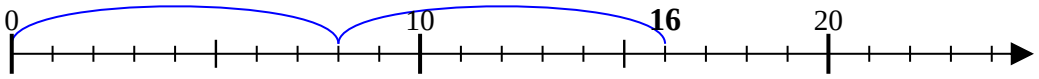

9) 24÷8=

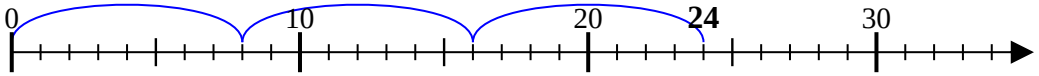

10) 12÷4=

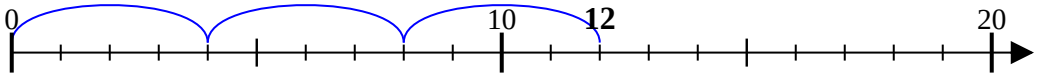

11) 32÷8=

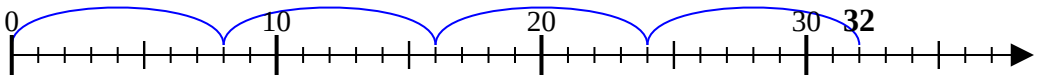

Answers

1. 4
2. 5
3. 3
4. 2
5. 3
6. 3
7. 3
8. 2
9. 3
10. 3
11. 4

1-10	91	82	73	64	55	45	36	27	18	9
11	0									