Completing and Matching Volume Equations Name:

Match each problem with the equation that could represent it. Answer with the missing term and letter.

Ex) 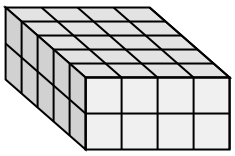

1) 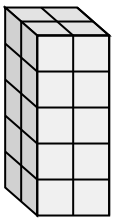

2) 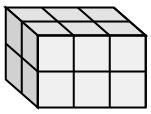

3) 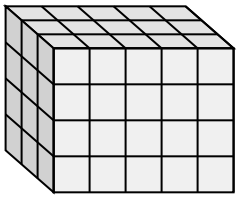

4) 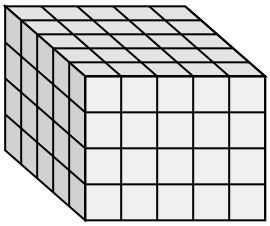

5) 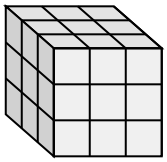

6) 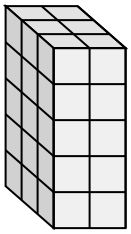

7) 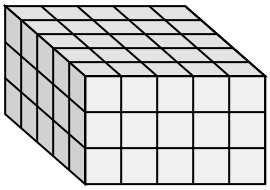

8) 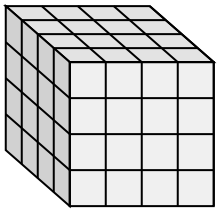

9) 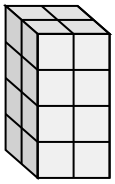

10) 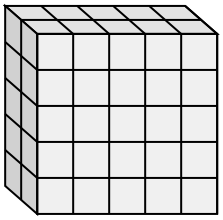

11) 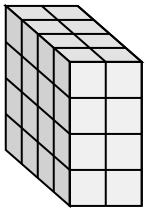

A. 5 × ___ × 4 = 100

B. 5 × 4 × ___ = 40

C. 5 × 5 × ___ = 75

D. ___ × 5 × 5 = 50

E. 3 × 5 × ___ = 60

F. 3 × 2 × 5 = ___

G. 4 × 2 × 4 = ___

H. 2 × 2 × ___ = 16

I. 2 × 3 × ___ = 12

J. 2 × 2 × 5 = ___

K. 3 × 3 × 3 = ___

L. 4 × ___ × 4 = 64

Answers

Ex. **B , 2**

1. _____
2. _____
3. _____
4. _____
5. _____
6. _____
7. _____
8. _____
9. _____
10. _____
11. _____

1-10	91	82	73	64	55	45	36	27	18	9
11	0									

Completing and Matching Volume Equations Name: **Answer Key**

Match each problem with the equation that could represent it. Answer with the missing term and letter.

Ex) 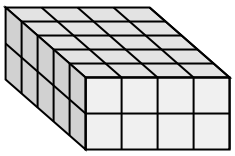

1) 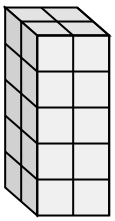

2) 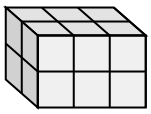

3) 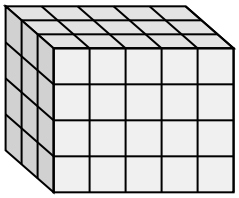

4) 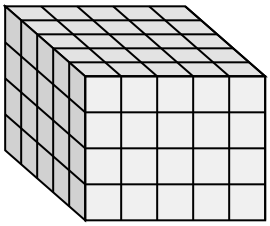

5) 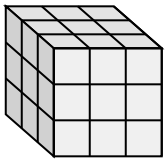

6) 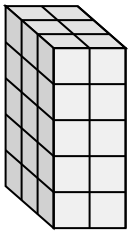

7) 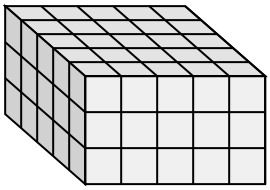

8) 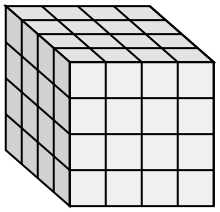

9) 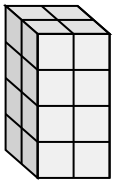

10) 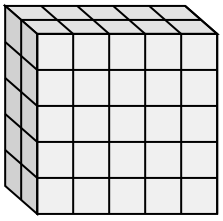

11) 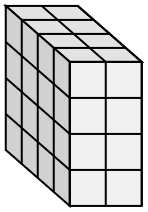

A. 5 × ___ × 4 = 100

B. 5 × 4 × ___ = 40

C. 5 × 5 × ___ = 75

D. ___ × 5 × 5 = 50

E. 3 × 5 × ___ = 60

F. 3 × 2 × 5 = ___

G. 4 × 2 × 4 = ___

H. 2 × 2 × ___ = 16

I. 2 × 3 × ___ = 12

J. 2 × 2 × 5 = ___

K. 3 × 3 × 3 = ___

L. 4 × ___ × 4 = 64

Answers

Ex.	B , 2
1.	J , 20
2.	I , 2
3.	E , 4
4.	A , 5
5.	K , 27
6.	F , 30
7.	C , 3
8.	L , 4
9.	H , 4
10.	D , 2
11.	G , 32

1-10	91	82	73	64	55	45	36	27	18	9
11	0									