Finding Angles within Shapes

Name:

Count the number of Acute, Obtuse, Right and Reflex angles in each shape.

Ex)

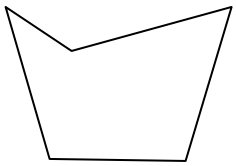

1)

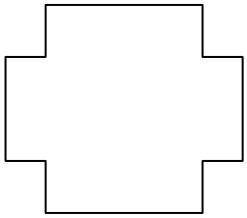

2)

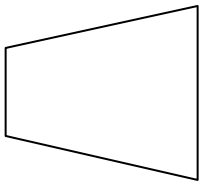

3)

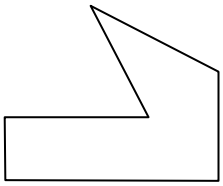

4)

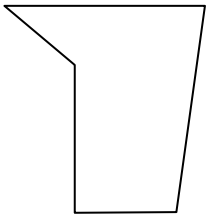

5)



6)

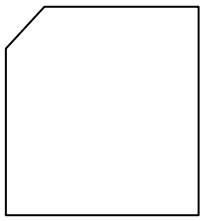

7)

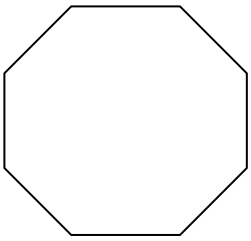

8)

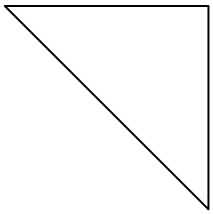

9)

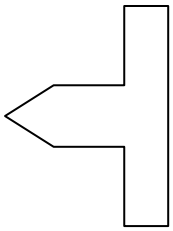

10)

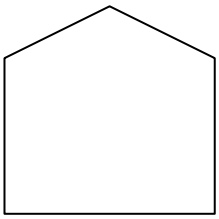

11)

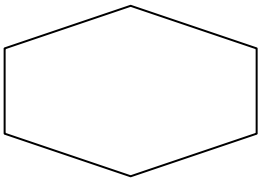

Answers

Ex.	2	2	0	1
1.				
2.				
3.				
4.				
5.				
6.				
7.				
8.				
9.				
10.				
11.				

1-10	91	82	73	64	55	45	36	27	18	9
11	0									

Finding Angles within Shapes

Name: **Answer Key**

Count the number of Acute, Obtuse, Right and Reflex angles in each shape.

Ex)

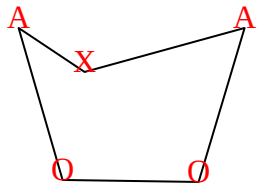

1)

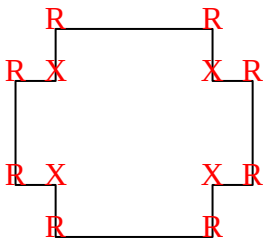

2)

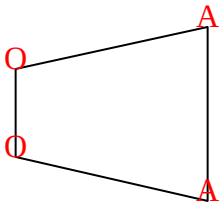

3)

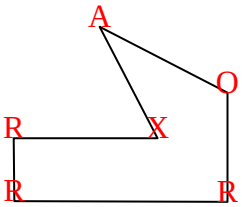

4)

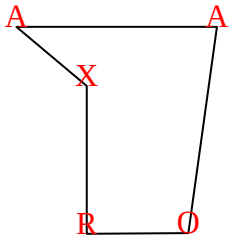

5)

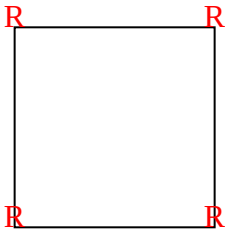

6)

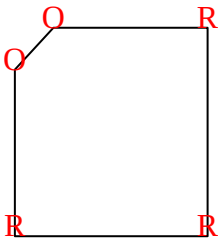

7)

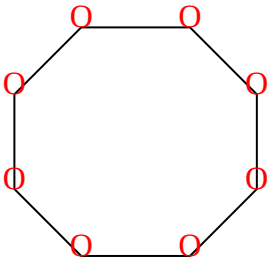

8)

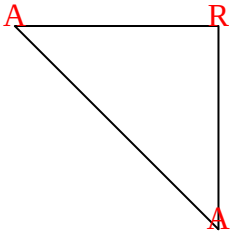

9)

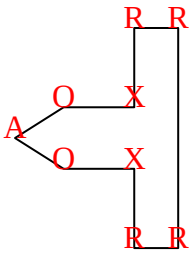

10)

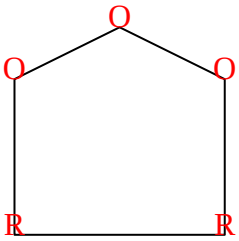

11)

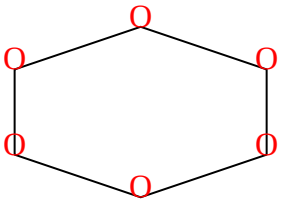

Answers

Ex.	2	2	0	1
1.	0	0	8	4
2.	2	2	0	0
3.	1	1	3	1
4.	2	1	1	1
5.	0	0	4	0
6.	0	2	3	0
7.	0	8	0	0
8.	2	0	1	0
9.	1	2	4	2
10.	0	3	2	0
11.	0	0	6	0

1-10	91	82	73	64	55	45	36	27	18	9
11	0									