Function Machines (Add & Subtract) Name:

Determine the rule each function machine is using.

Ex)

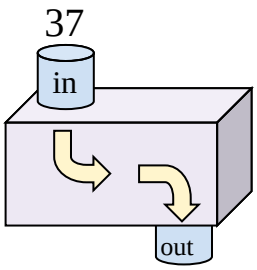

Subtract 14

1)

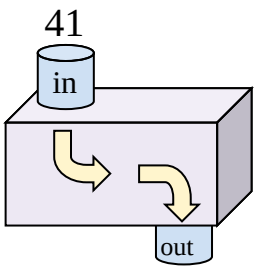

2)

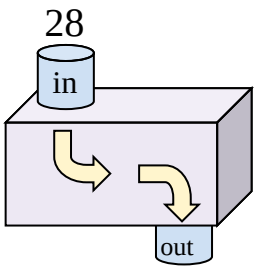

3)

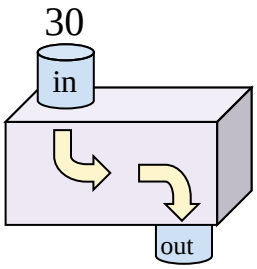

4)

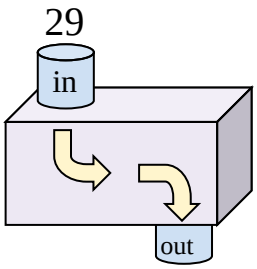

5)

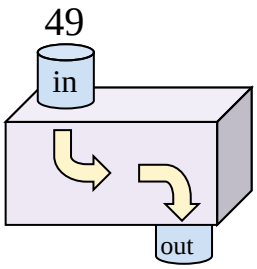

6)

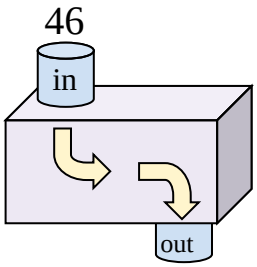

7)

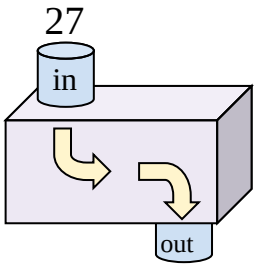

8)

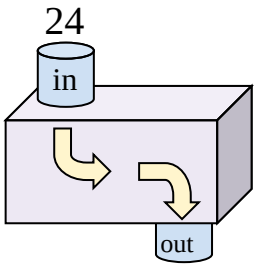

9)

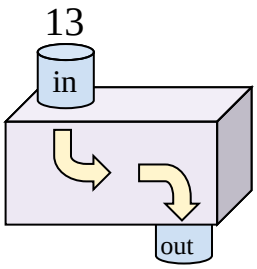

10)

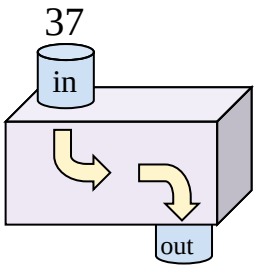

11)

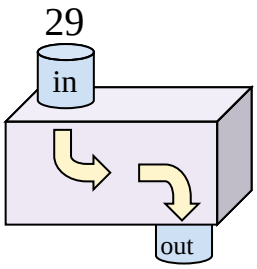

Answers

Ex. Subtract 14

1. _____
2. _____
3. _____
4. _____
5. _____
6. _____
7. _____
8. _____
9. _____
10. _____
11. _____

1-10	91	82	73	64	55	45	36	27	18	9
11	0									

Function Machines (Add & Subtract) Name: **Answer Key**

Determine the rule each function machine is using.

Ex)

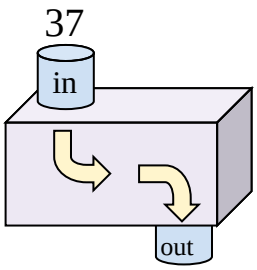

Subtract 14

1)

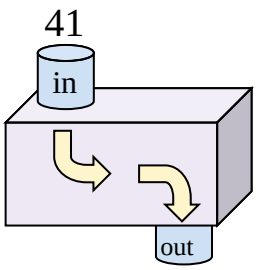

Subtract 19

2)

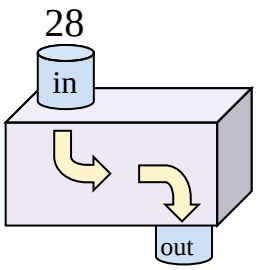

Add 16

3)

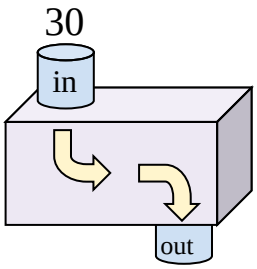

Add 14

4)

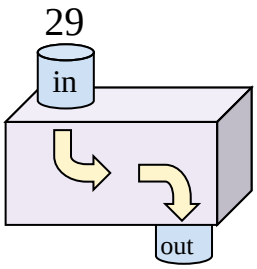

Add 21

5)

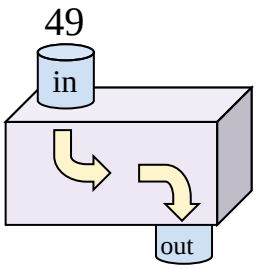

Subtract 33

6)

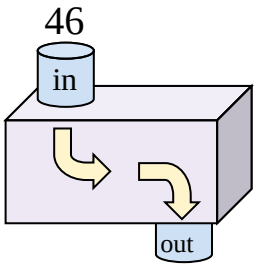

Subtract 29

7)

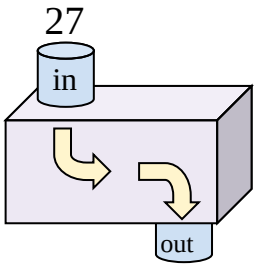

Add 9

8)

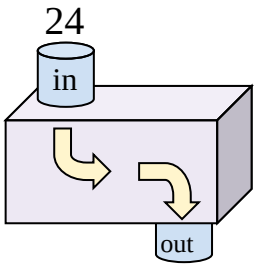

Add 6

9)

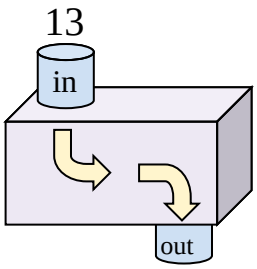

Add 12

10)

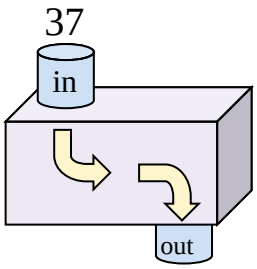

Subtract 7

11)

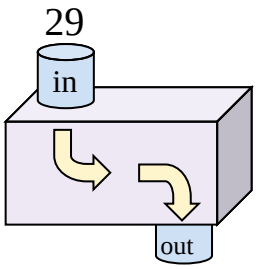

Add 16

Answers

Ex.	Subtract 14
1.	Subtract 19
2.	Add 16
3.	Add 14
4.	Add 21
5.	Subtract 33
6.	Subtract 29
7.	Add 9
8.	Add 6
9.	Add 12
10.	Subtract 7
11.	Add 16

1-10	91	82	73	64	55	45	36	27	18	9
11	0									