Finding Distance on a Grid

Name:

**Find the distance between points. Round your answer to the nearest tenth.**

Ex)

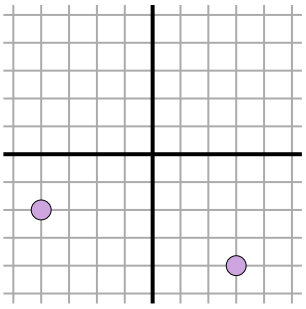

1)

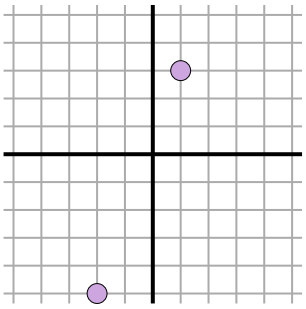

2)

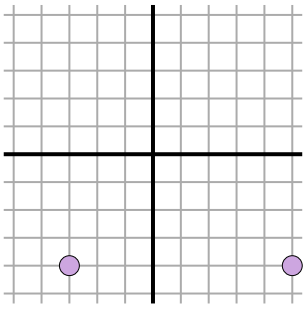

3)

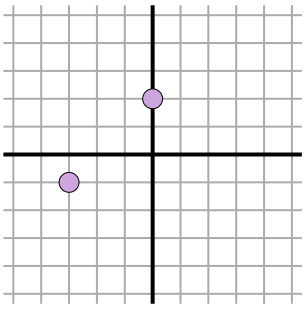

4)

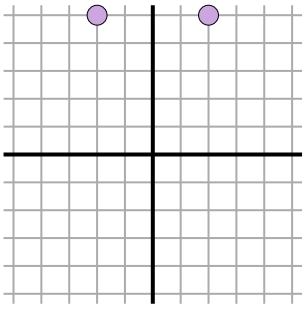

5)

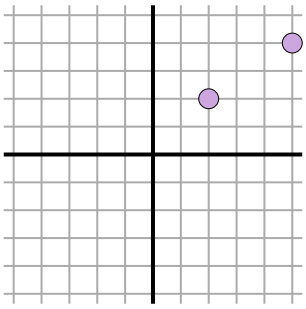

6)

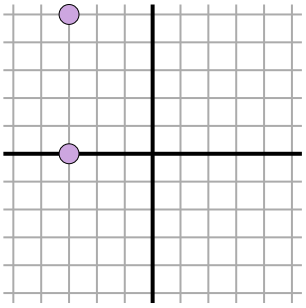

7)

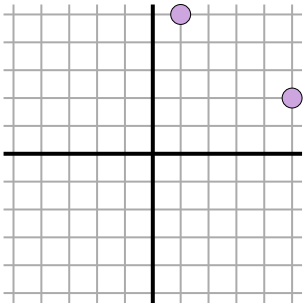

8)

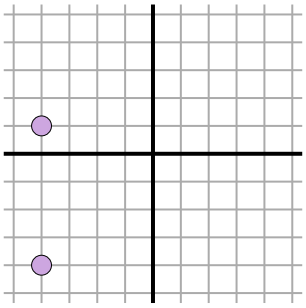

9)

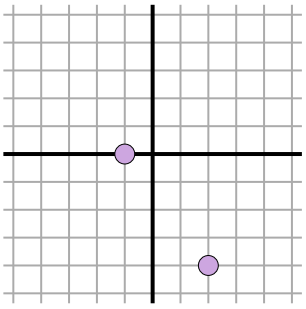

10)

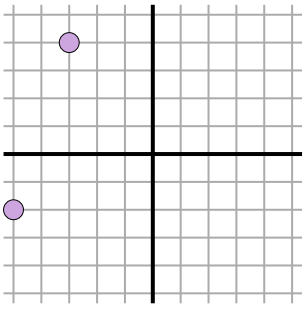

11)

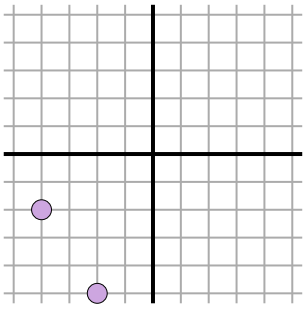

**Answers**

Ex. 7.3

1. _____

2. _____

3. _____

4. _____

5. _____

6. _____

7. _____

8. _____

9. _____

10. _____

11. _____



| | | | | | | | | | | |
|---|---|---|---|---|---|---|---|---|---|---|
| 1-10 | 91 | 82 | 73 | 64 | 55 | 45 | 36 | 27 | 18 | 9 |
| 11 | 0 | | | | | | | | | |

Finding Distance on a Grid

Name: **Answer Key**

**Find the distance between points. Round your answer to the nearest tenth.**

**Ex)**

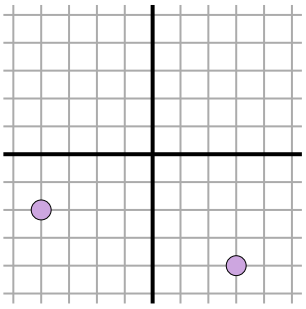

$\sqrt{(3--4)^2 + (-4--2)^2}$

$\sqrt{(49) + (4)}$

**1)**

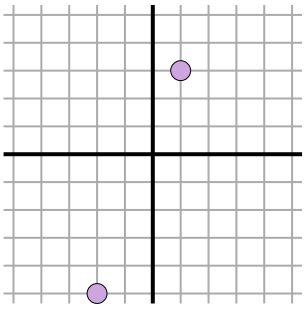

$\sqrt{(1--2)^2 + (3--5)^2}$

$\sqrt{(9) + (64)}$

**2)**

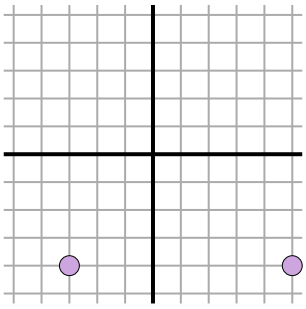

$\sqrt{(5--3)^2 + (-4--4)^2}$

$\sqrt{(64) + (0)}$

**3)**

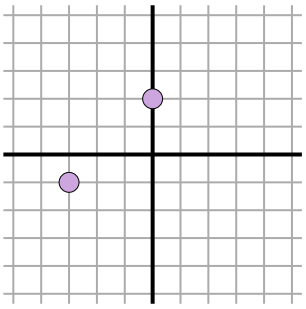

$\sqrt{(0--3)^2 + (2--1)^2}$

$\sqrt{(9) + (9)}$

**4)**

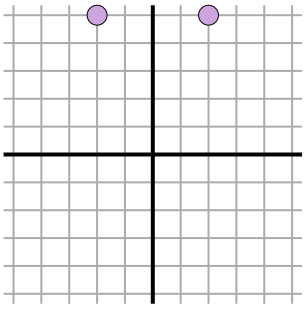

$\sqrt{(2--2)^2 + (5-5)^2}$

$\sqrt{(16) + (0)}$

**5)**

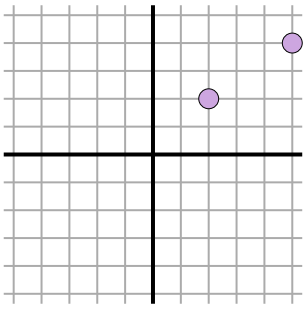

$\sqrt{(5-2)^2 + (4-2)^2}$

$\sqrt{(9) + (4)}$

**6)**

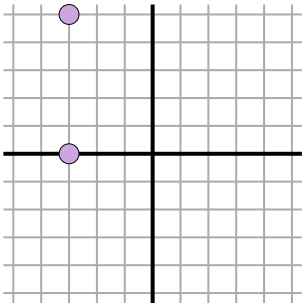

$\sqrt{(-3--3)^2 + (5-0)^2}$

$\sqrt{(0) + (25)}$

**7)**

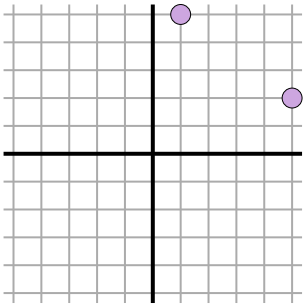

$\sqrt{(1-5)^2 + (5-2)^2}$

$\sqrt{(16) + (9)}$

**8)**

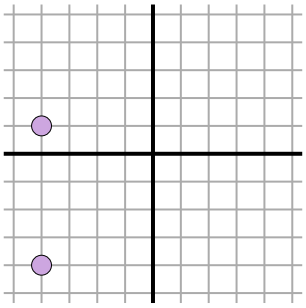

$\sqrt{(-4--4)^2 + (1--4)^2}$

$\sqrt{(0) + (25)}$

**9)**

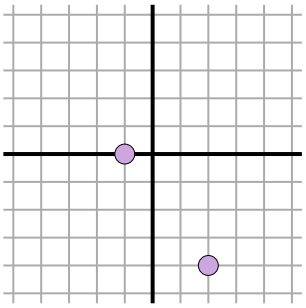

$\sqrt{(-1-2)^2 + (0--4)^2}$

$\sqrt{(9) + (16)}$

**10)**

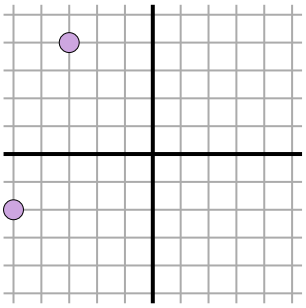

$\sqrt{(-5--3)^2 + (-2-4)^2}$

$\sqrt{(4) + (36)}$

**11)**

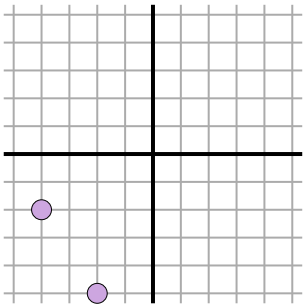

$\sqrt{(-4--2)^2 + (-2--5)^2}$

$\sqrt{(4) + (9)}$

## Answers

| | |
|---|---|
| Ex. | 7.3 |
| 1. | 8.5 |
| 2. | 8 |
| 3. | 4.2 |
| 4. | 4 |
| 5. | 3.6 |
| 6. | 5 |
| 7. | 5 |
| 8. | 5 |
| 9. | 5 |
| 10. | 6.3 |
| 11. | 3.6 |



| | | | | | | | | | | |
|---|---|---|---|---|---|---|---|---|---|---|
| 1-10 | 91 | 82 | 73 | 64 | 55 | 45 | 36 | 27 | 18 | 9 |
| 11 | 0 | | | | | | | | | |