Improper and Mixed Fractions Visual Name:

**Write each amount as a mixed number.**

1) 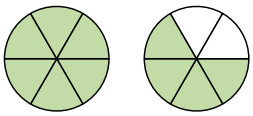

2) 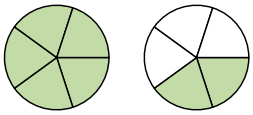

3) 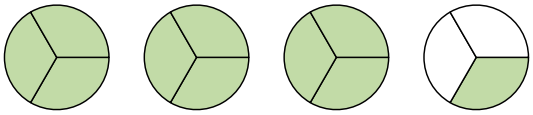

4) 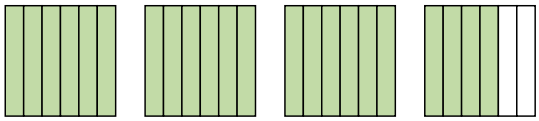

5) 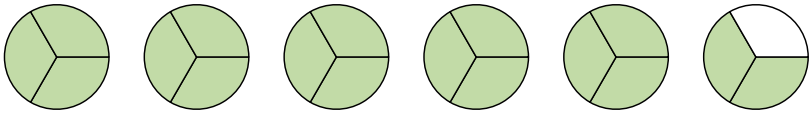

**Write each amount as an improper fraction.**

6) 

7) 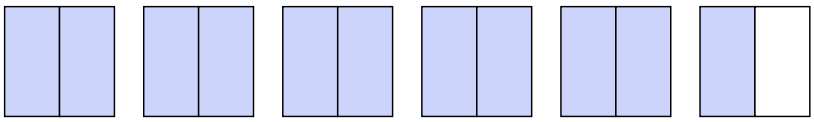

8) 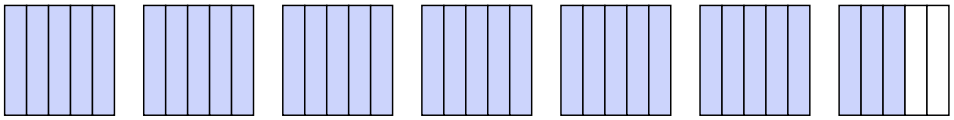

9) 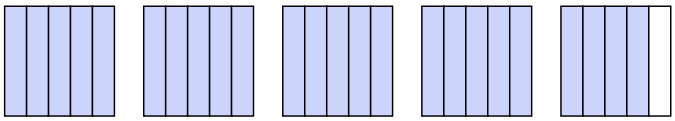

10) 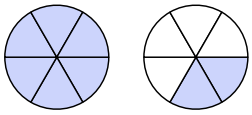

11) 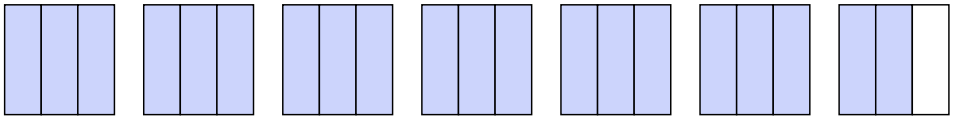

**Answers**

1. _____
2. _____
3. _____
4. _____
5. _____
6. _____
7. _____
8. _____
9. _____
10. _____
11. _____



| | | | | | | | | | | |
|---|---|---|---|---|---|---|---|---|---|---|
| 1-10 | 91 | 82 | 73 | 64 | 55 | 45 | 36 | 27 | 18 | 9 |
| 11 | 0 | | | | | | | | | |

Improper and Mixed Fractions Visual

Name: **Answer Key**

**Write each amount as a mixed number.**

1) 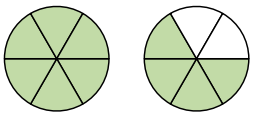

2) 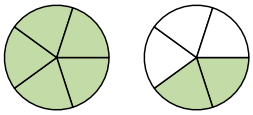

3) 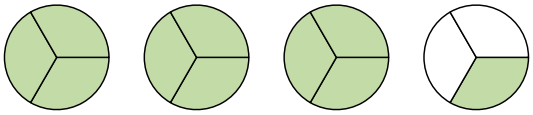

4) 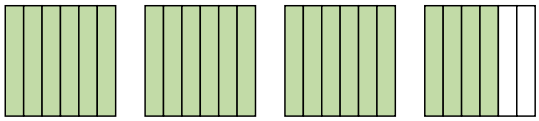

5) 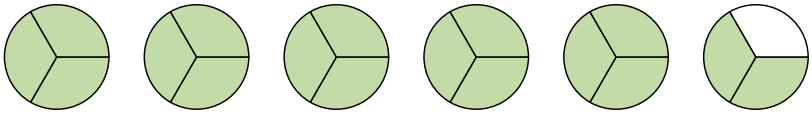

**Write each amount as an improper fraction.**

6) 

7) 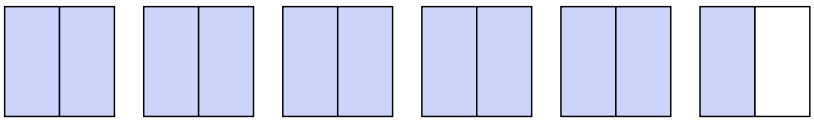

8) 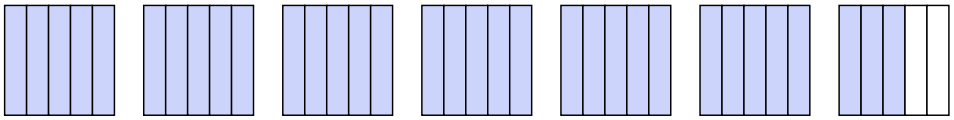

9) 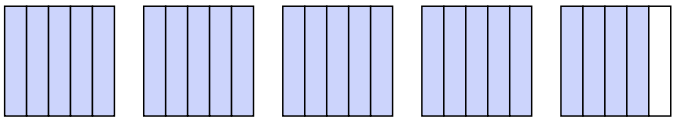

10) 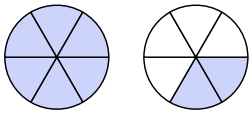

11) 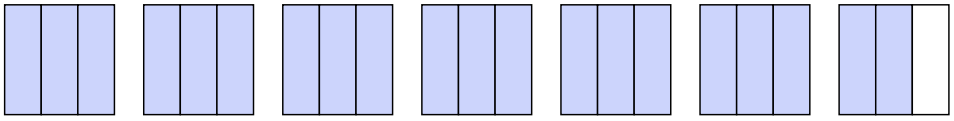

**Answers**

1. $1\frac{4}{6}$
2. $1\frac{2}{5}$
3. $3\frac{1}{3}$
4. $3\frac{4}{6}$
5. $5\frac{2}{3}$
6. $\frac{5}{2}$
7. $\frac{11}{2}$
8. $\frac{33}{5}$
9. $\frac{24}{5}$
10. $\frac{8}{6}$
11. $\frac{20}{3}$



| | | | | | | | | | | |
|---|---|---|---|---|---|---|---|---|---|---|
| 1-10 | 91 | 82 | 73 | 64 | 55 | 45 | 36 | 27 | 18 | 9 |
| 11 | 0 | | | | | | | | | |