Dividing with a Numberline

Name:

Use the numberline to solve each problem.

1) 36÷9=

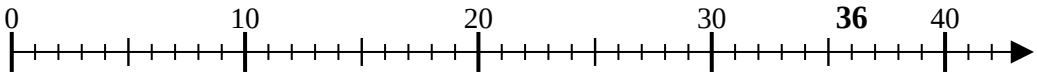

2) 6÷3=

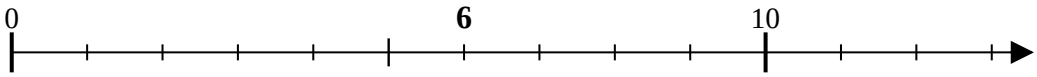

3) 21÷7=

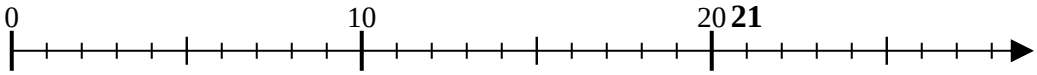

4) 15÷3=

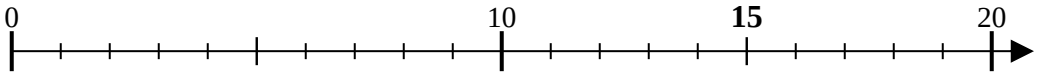

5) 40÷10=

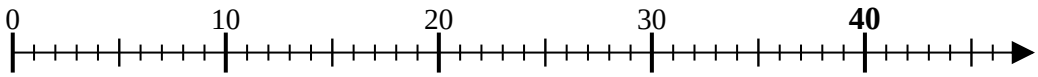

6) 12÷3=

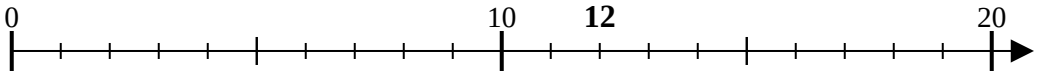

7) 6÷2=

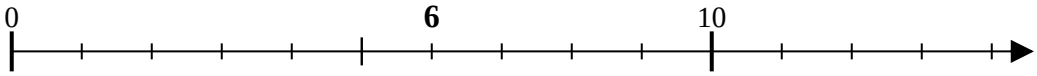

8) 14÷7=

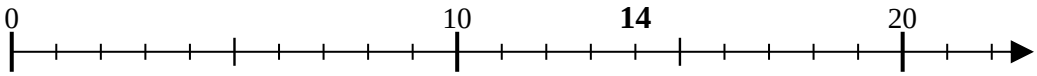

9) 10÷2=

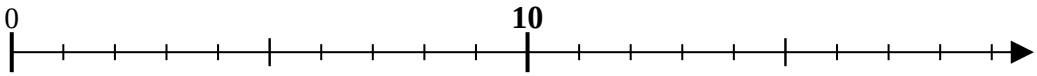

10) 20÷5=

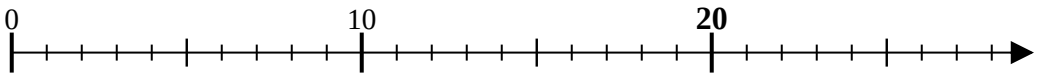

11) 9÷3=

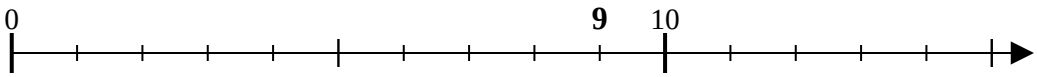

Answers

1. _____
2. _____
3. _____
4. _____
5. _____
6. _____
7. _____
8. _____
9. _____
10. _____
11. _____

1-10	91	82	73	64	55	45	36	27	18	9
11	0									

Dividing with a Numberline

Name: **Answer Key**

Use the numberline to solve each problem.

1) 36÷9=

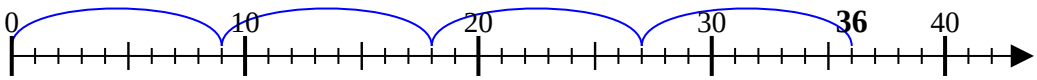

2) 6÷3=

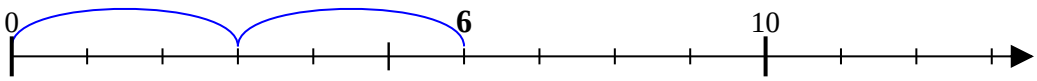

3) 21÷7=

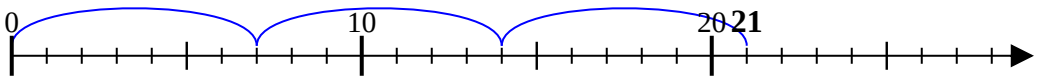

4) 15÷3=

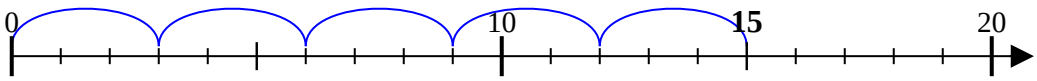

5) 40÷10=

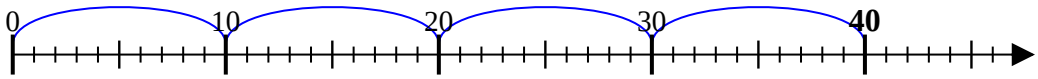

6) 12÷3=

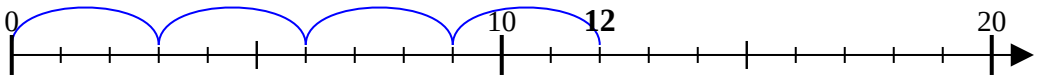

7) 6÷2=

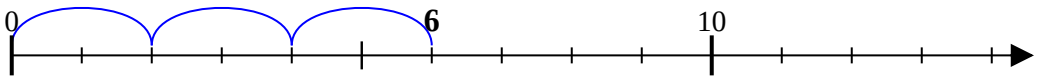

8) 14÷7=

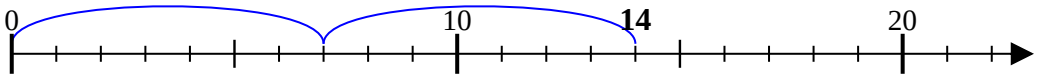

9) 10÷2=

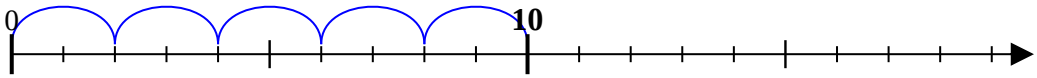

10) 20÷5=

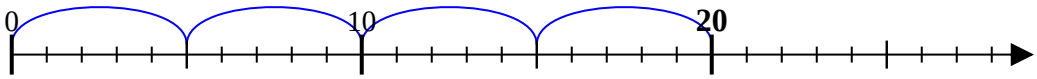

11) 9÷3=

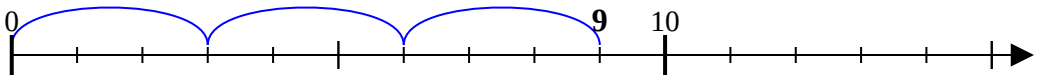

Answers

1. 4
2. 2
3. 3
4. 5
5. 4
6. 4
7. 3
8. 2
9. 5
10. 4
11. 3

1-10	91	82	73	64	55	45	36	27	18	9
11	0									