Dividing with a Numberline Name:

**Use the numberline to solve each problem.**

**1)** 24÷6=

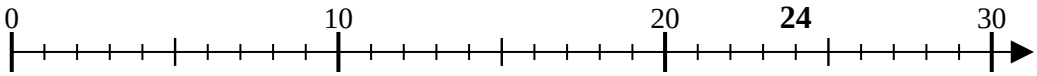


**2)** 16÷8=

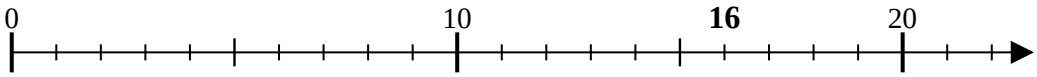


**3)** 10÷2=

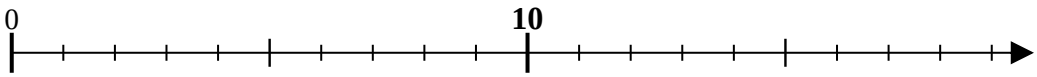


**4)** 40÷8=

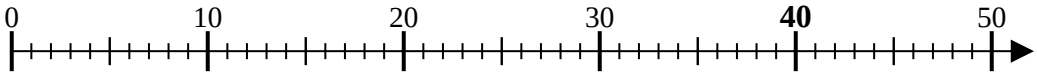


**5)** 6÷2=

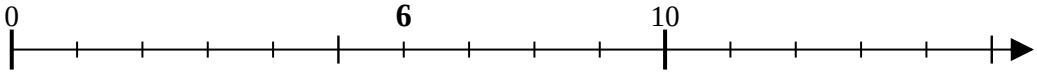


**6)** 40÷10=

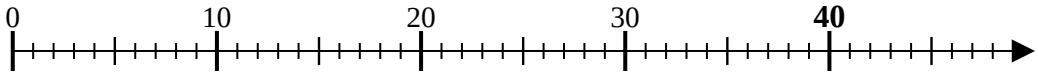


**7)** 15÷3=

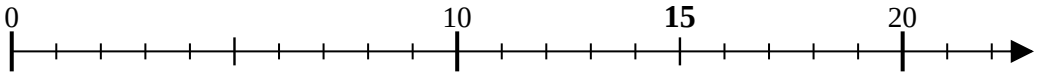


**8)** 18÷9=

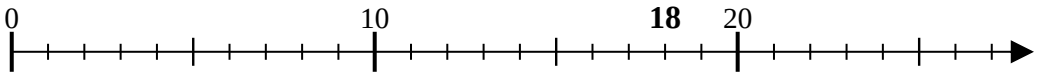


**9)** 27÷9=

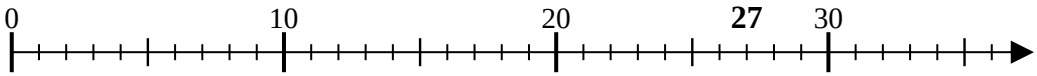


**10)** 36÷9=

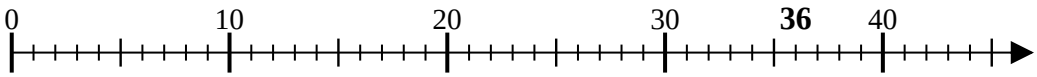


**11)** 8÷4=

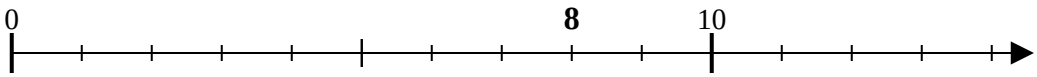


**Answers**

1. _____
2. _____
3. _____
4. _____
5. _____
6. _____
7. _____
8. _____
9. _____
10. _____
11. _____



| | | | | | | | | | | |
|---|---|---|---|---|---|---|---|---|---|---|
| 1-10 | 91 | 82 | 73 | 64 | 55 | 45 | 36 | 27 | 18 | 9 |
| 11 | 0 | | | | | | | | | |

Dividing with a Numberline

Name: **Answer Key**

**Use the numberline to solve each problem.**

**1)** 24÷6=

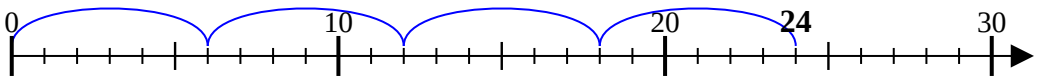


**2)** 16÷8=

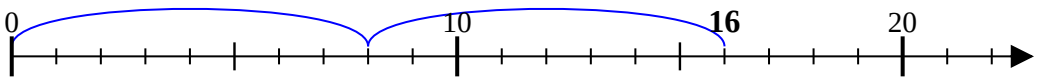


**3)** 10÷2=

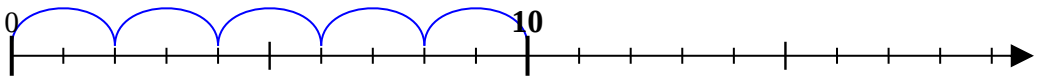


**4)** 40÷8=

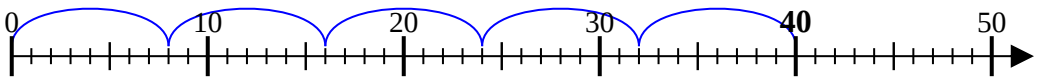


**5)** 6÷2=

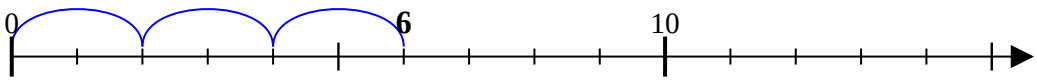


**6)** 40÷10=

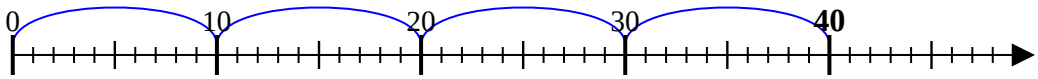


**7)** 15÷3=

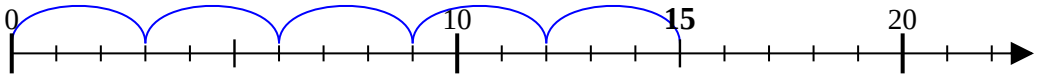


**8)** 18÷9=

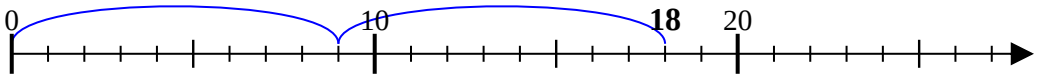


**9)** 27÷9=

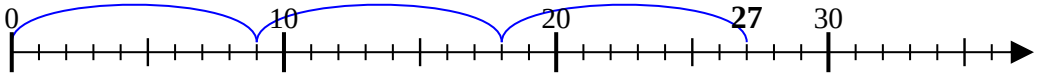


**10)** 36÷9=

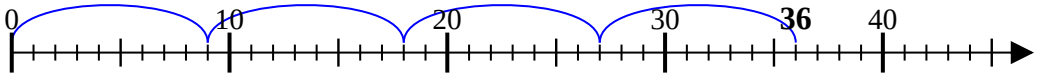


**11)** 8÷4=

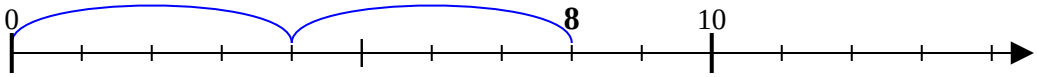


**Answers**

1. 4
2. 2
3. 5
4. 5
5. 3
6. 4
7. 5
8. 2
9. 3
10. 4
11. 2



| | | | | | | | | | | |
|---|---|---|---|---|---|---|---|---|---|---|
| 1-10 | 91 | 82 | 73 | 64 | 55 | 45 | 36 | 27 | 18 | 9 |
| 11 | 0 | | | | | | | | | |