Dividing with a Numberline Name:

**Use the numberline to solve each problem.**

**1)** 35÷7=

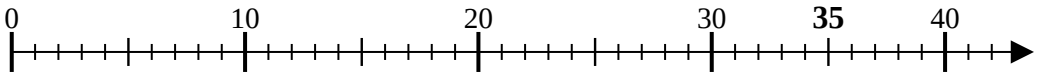


**2)** 21÷7=

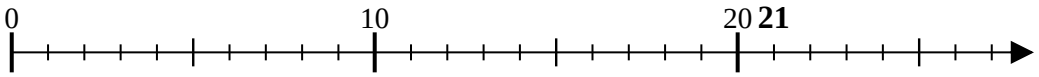


**3)** 12÷6=

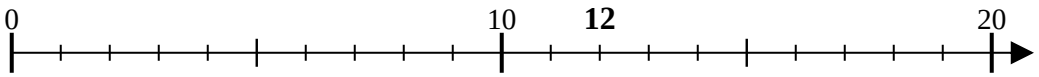


**4)** 6÷2=

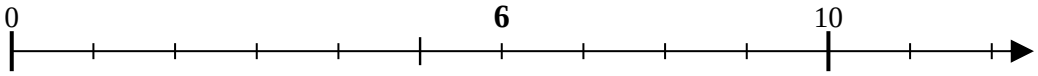


**5)** 28÷7=

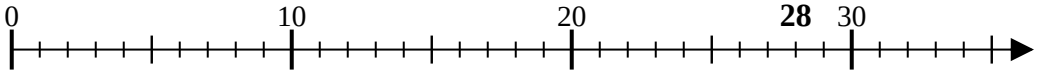


**6)** 10÷2=

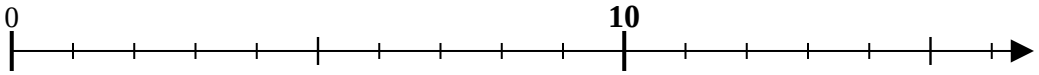


**7)** 9÷3=

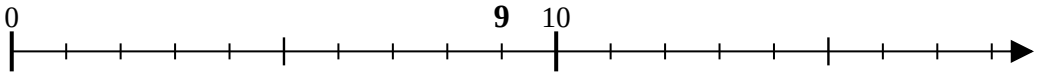


**8)** 18÷6=

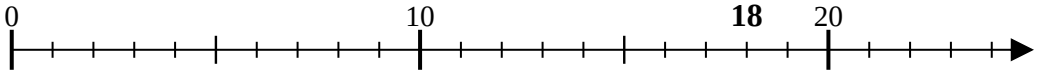


**9)** 10÷5=

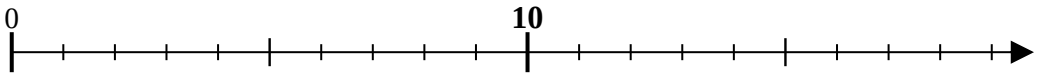


**10)** 18÷9=

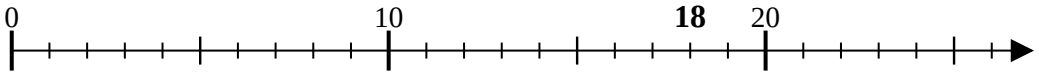


**11)** 24÷6=

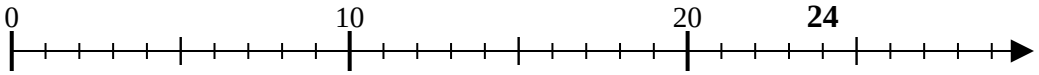


**Answers**

1. _____
2. _____
3. _____
4. _____
5. _____
6. _____
7. _____
8. _____
9. _____
10. _____
11. _____



| | | | | | | | | | | |
|---|---|---|---|---|---|---|---|---|---|---|
| 1-10 | 91 | 82 | 73 | 64 | 55 | 45 | 36 | 27 | 18 | 9 |
| 11 | 0 | | | | | | | | | |

Dividing with a Numberline

Name: **Answer Key**

**Use the numberline to solve each problem.**

**1)** 35÷7=

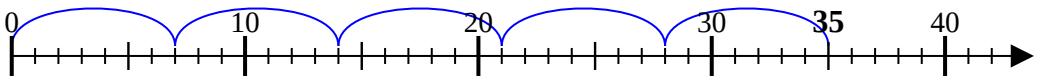


**2)** 21÷7=

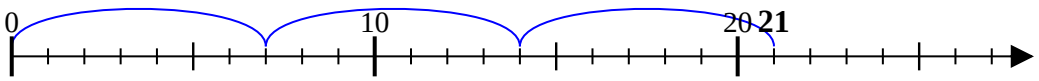


**3)** 12÷6=

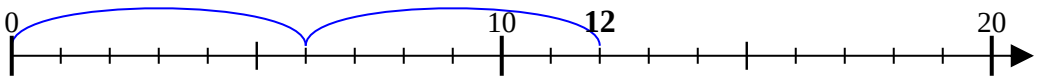


**4)** 6÷2=

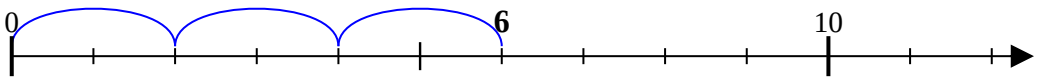


**5)** 28÷7=

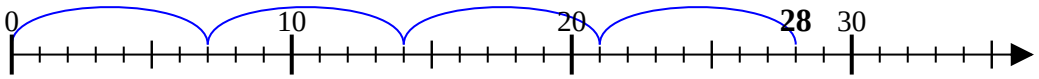


**6)** 10÷2=

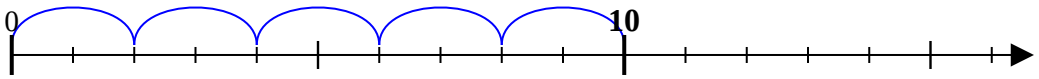


**7)** 9÷3=

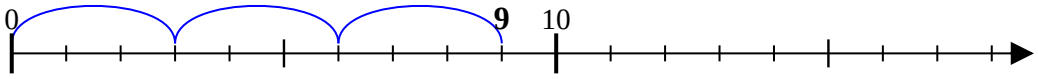


**8)** 18÷6=

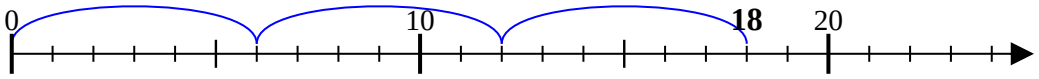


**9)** 10÷5=

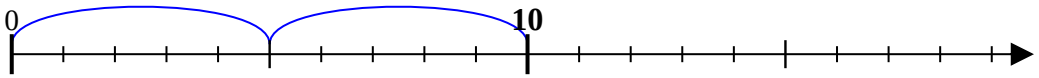


**10)** 18÷9=

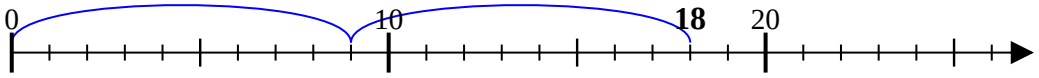


**11)** 24÷6=

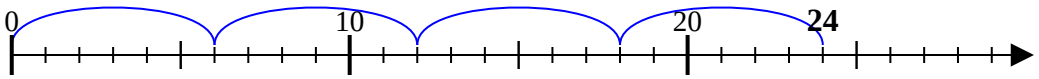


**Answers**

1. 5
2. 3
3. 2
4. 3
5. 4
6. 5
7. 3
8. 3
9. 2
10. 2
11. 4



| | | | | | | | | | | |
|---|---|---|---|---|---|---|---|---|---|---|
| 1-10 | 91 | 82 | 73 | 64 | 55 | 45 | 36 | 27 | 18 | 9 |
| 11 | 0 | | | | | | | | | |