Function Machines (Add & Subtract) Name:

Determine the rule each function machine is using.

Ex)

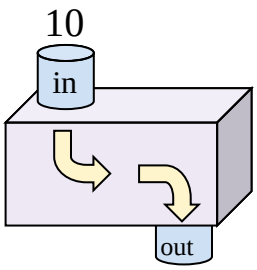

Add 21

1)

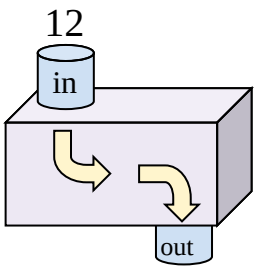

2)

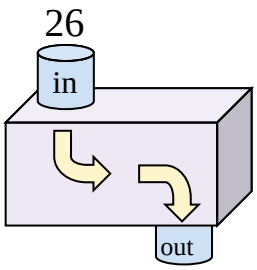

3)

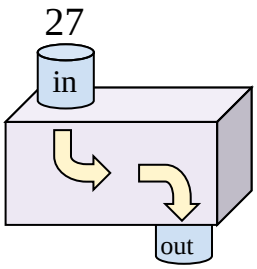

4)

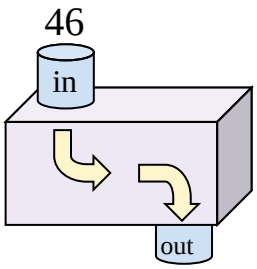

5)

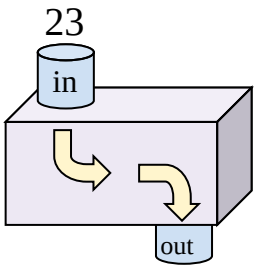

6)

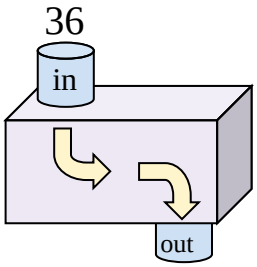

7)

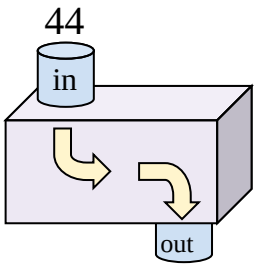

8)

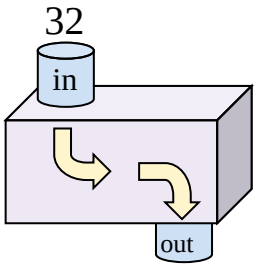

9)

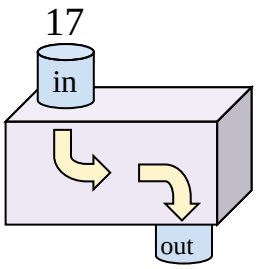

10)

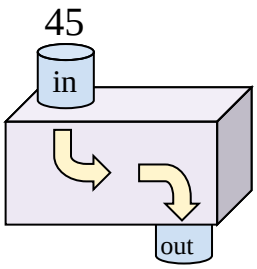

11)

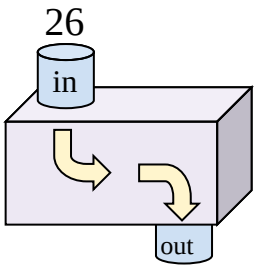

Answers

Ex. Add 21

1. _____
2. _____
3. _____
4. _____
5. _____
6. _____
7. _____
8. _____
9. _____
10. _____
11. _____

Function Machines (Add & Subtract) Name: **Answer Key**

Determine the rule each function machine is using.

Ex)

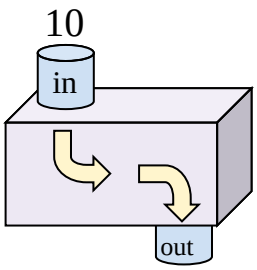

Add 21

1)

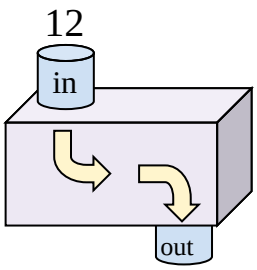

Add 7

2)

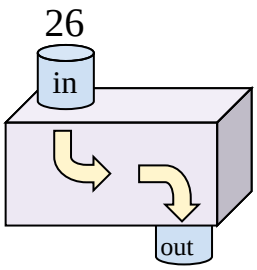

Add 12

3)

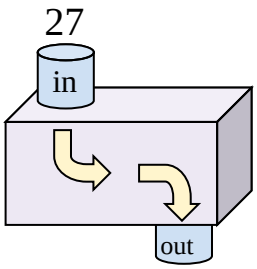

Add 20

4)

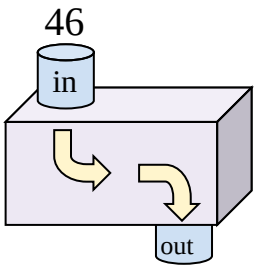

Subtract 24

5)

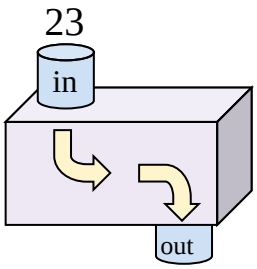

Add 14

6)

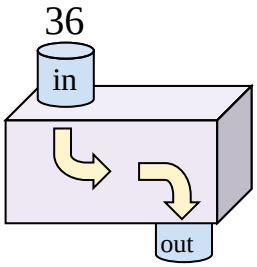

Subtract 11

7)

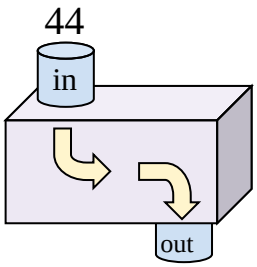

Subtract 34

8)

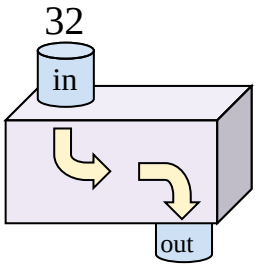

Subtract 5

9)

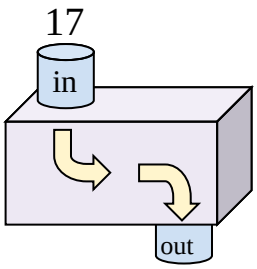

Add 19

10)

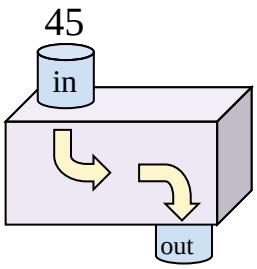

Subtract 16

11)

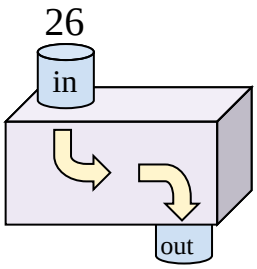

Add 5

Answers

Ex.	Add 21
1.	Add 7
2.	Add 12
3.	Add 20
4.	Subtract 24
5.	Add 14
6.	Subtract 11
7.	Subtract 34
8.	Subtract 5
9.	Add 19
10.	Subtract 16
11.	Add 5