Rewriting Multiplication Problems (visual)

Name:

Write each array as a multiplication problem and solve.

Ex)

1)



2)



3)

4)



5)

6)

7)

8)



9)



10)

11)

Answers

Ex. 9 × 6 = 54

1. _____
2. _____
3. _____
4. _____
5. _____
6. _____
7. _____
8. _____
9. _____
10. _____
11. _____

1-10	91	82	73	64	55	45	36	27	18	9
11	0									

Rewriting Multiplication Problems (visual) Name: **Answer Key**

Write each array as a multiplication problem and solve.

Ex)

1)



2)



3)

4)

5)

6)

7)

8)



9)



10)

11)

Answers

Ex.	9 × 6 = 54
1.	7 × 6 = 42
2.	7 × 10 = 70
3.	8 × 2 = 16
4.	4 × 2 = 8
5.	4 × 8 = 32
6.	3 × 2 = 6
7.	10 × 7 = 70
8.	4 × 10 = 40
9.	3 × 6 = 18
10.	7 × 5 = 35
11.	4 × 6 = 24

1-10	91	82	73	64	55	45	36	27	18	9
11	0									