Fraction Quantity Relative to Whole

Name:

Solve each problem.

Ex) Express the moons as a fraction of the entire set.

1) Express the moons as a fraction of the entire set.



2) Express the hearts as a fraction of the entire set.



3) Express the triangles as a fraction of the entire set.



4) Express the stars as a fraction of the entire set.



5) Express the stars as a fraction of the entire set.

6) Express the pentagons as a fraction of the entire set.



7) Express the circles as a fraction of the entire set.

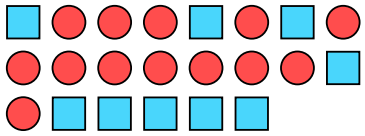

8) Express the stars as a fraction of the entire set.

9) Express the triangles as a fraction of the entire set.

10) Express the stars as a fraction of the entire set.

11) Express the stars as a fraction of the entire set.

Answers

Ex. 5/15

1. _____
2. _____
3. _____
4. _____
5. _____
6. _____
7. _____
8. _____
9. _____
10. _____
11. _____

1-10	91	82	73	64	55	45	36	27	18	9
11	0									

Fraction Quantity Relative to Whole

Name: **Answer Key**

Solve each problem.

Ex) Express the moons as a fraction of the entire set.

1) Express the moons as a fraction of the entire set.



2) Express the hearts as a fraction of the entire set.



3) Express the triangles as a fraction of the entire set.



4) Express the stars as a fraction of the entire set.



5) Express the stars as a fraction of the entire set.

6) Express the pentagons as a fraction of the entire set.



7) Express the circles as a fraction of the entire set.

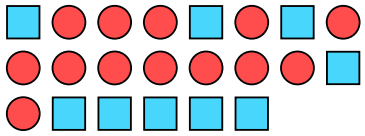

8) Express the stars as a fraction of the entire set.

9) Express the triangles as a fraction of the entire set.

10) Express the stars as a fraction of the entire set.

11) Express the stars as a fraction of the entire set.

Answers

Ex.	5/15
1.	14/27
2.	11/18
3.	14/29
4.	8/11
5.	2/5
6.	4/9
7.	13/22
8.	15/22
9.	10/18
10.	2/6
11.	2/13

1-10	91	82	73	64	55	45	36	27	18	9
11	0									