Dividing with a Numberline Name:

**Use the numberline to solve each problem.**

**1)** 9÷3=

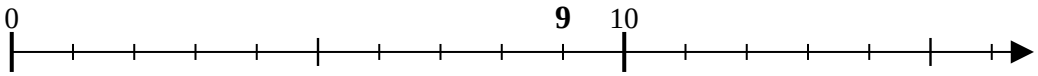


**2)** 6÷2=

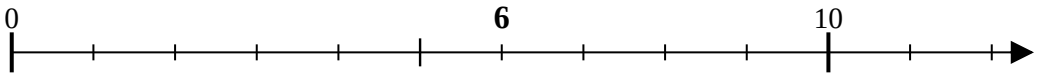


**3)** 12÷4=

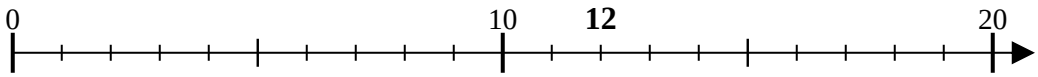


**4)** 15÷5=

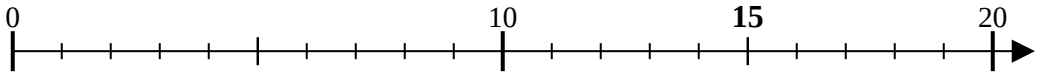


**5)** 28÷7=

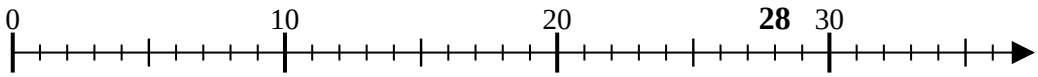


**6)** 40÷10=

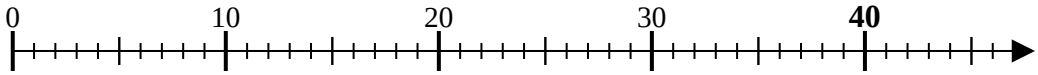


**7)** 24÷6=

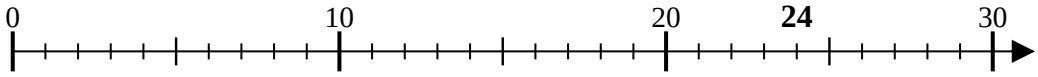


**8)** 30÷10=

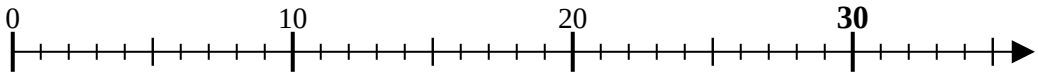


**9)** 30÷6=

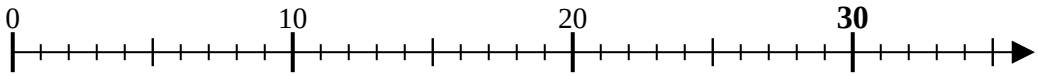


**10)** 12÷3=

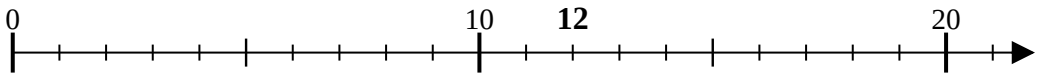


**11)** 18÷6=

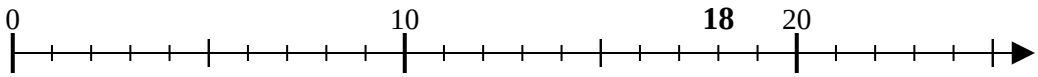


**Answers**

1. _____
2. _____
3. _____
4. _____
5. _____
6. _____
7. _____
8. _____
9. _____
10. _____
11. _____



| | | | | | | | | | | |
|---|---|---|---|---|---|---|---|---|---|---|
| 1-10 | 91 | 82 | 73 | 64 | 55 | 45 | 36 | 27 | 18 | 9 |
| 11 | 0 | | | | | | | | | |

Dividing with a Numberline

Name: **Answer Key**

**Use the numberline to solve each problem.**

**1)** 9÷3=

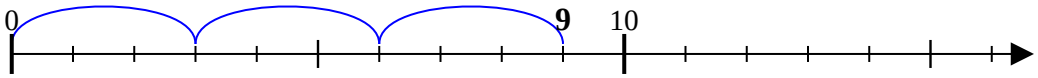


**2)** 6÷2=

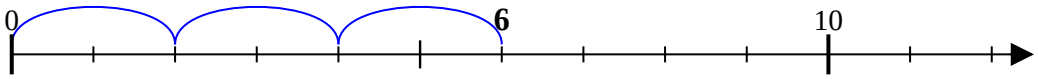


**3)** 12÷4=

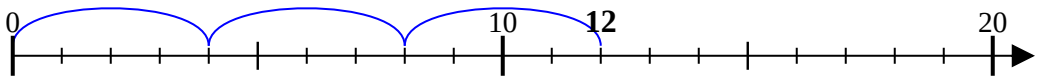


**4)** 15÷5=

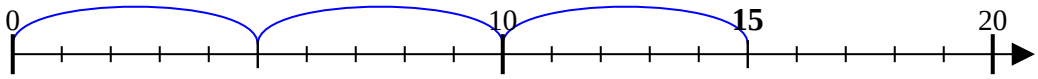


**5)** 28÷7=

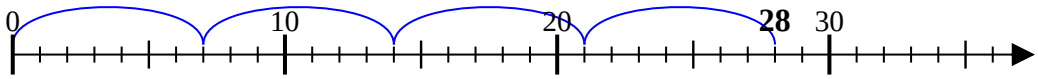


**6)** 40÷10=

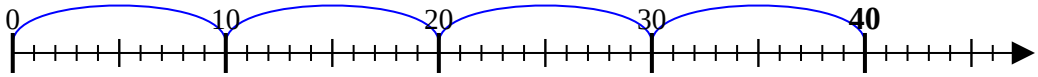


**7)** 24÷6=

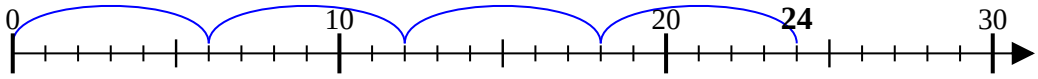


**8)** 30÷10=

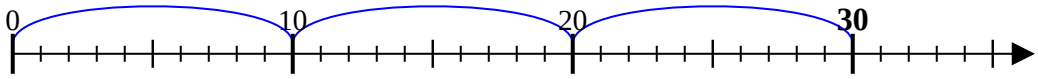


**9)** 30÷6=

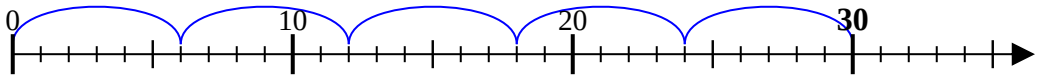


**10)** 12÷3=

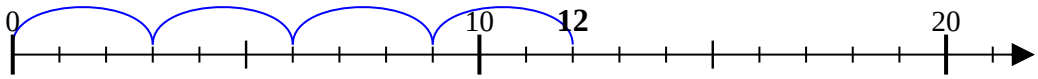


**11)** 18÷6=

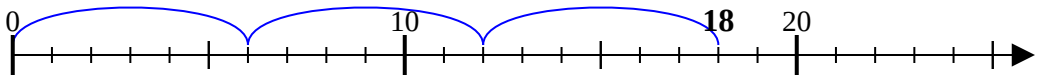


**Answers**

1. 3
2. 3
3. 3
4. 3
5. 4
6. 4
7. 4
8. 3
9. 5
10. 4
11. 3



| | | | | | | | | | | |
|---|---|---|---|---|---|---|---|---|---|---|
| 1-10 | 91 | 82 | 73 | 64 | 55 | 45 | 36 | 27 | 18 | 9 |
| 11 | 0 | | | | | | | | | |