Completing and Matching Volume Equations

Name:

Match each problem with the equation that could represent it. Answer with the missing term and letter.

Ex) 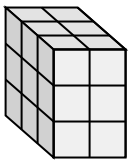

1) 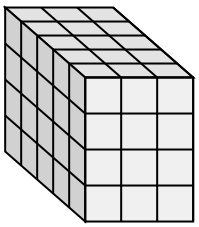

2) 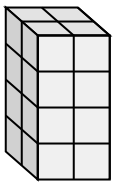

3) 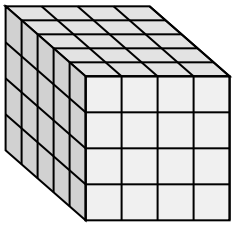

4) 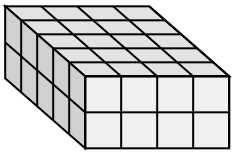

5) 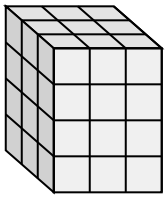

6) 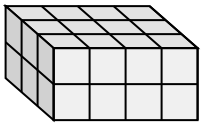

7) 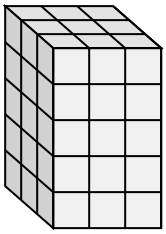

8) 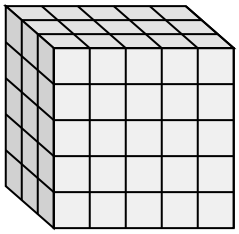

9) 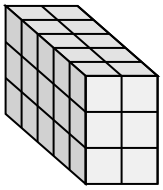

10) 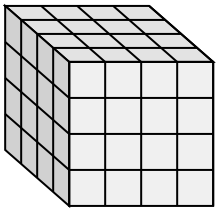

11) 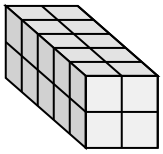

A. ___ × 3 × 4 = 36

B. 5 × ___ × 2 = 40

C. ___ × 2 × 3 = 18

D. 5 × 2 × 2 = ___

E. 5 × 3 × ___ = 60

F. 5 × ___ × 3 = 30

G. 4 × ___ × 4 = 64

H. ___ × 4 × 4 = 80

I. ___ × 4 × 2 = 24

J. ___ × 3 × 5 = 45

K. ___ × 2 × 4 = 16

L. 3 × 5 × 5 = ___

Answers

Ex. C , 3

1. _____
2. _____
3. _____
4. _____
5. _____
6. _____
7. _____
8. _____
9. _____
10. _____
11. _____

Completing and Matching Volume Equations Name: **Answer Key**

Match each problem with the equation that could represent it. Answer with the missing term and letter.

Ex) 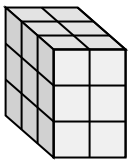

1) 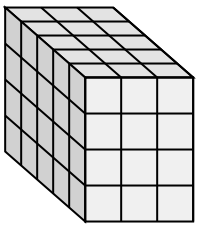

2) 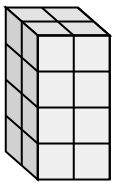

3) 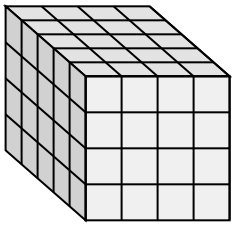

4) 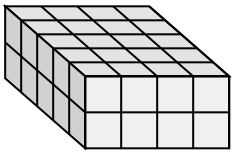

5) 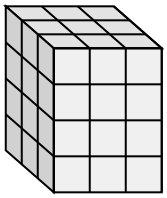

6) 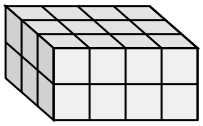

7) 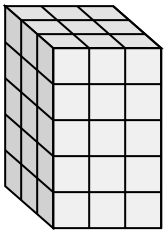

8) 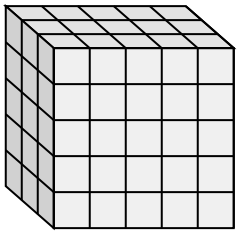

9) 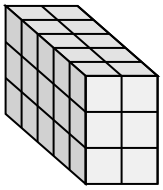

10) 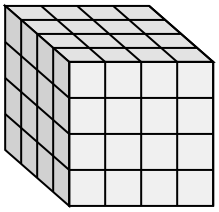

11) 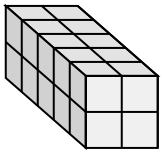

A. ___ × 3 × 4 = 36

B. 5 × ___ × 2 = 40

C. ___ × 2 × 3 = 18

D. 5 × 2 × 2 = ___

E. 5 × 3 × ___ = 60

F. 5 × ___ × 3 = 30

G. 4 × ___ × 4 = 64

H. ___ × 4 × 4 = 80

I. ___ × 4 × 2 = 24

J. ___ × 3 × 5 = 45

K. ___ × 2 × 4 = 16

L. 3 × 5 × 5 = ___

Answers

Ex.	C , 3
1.	E , 4
2.	K , 2
3.	H , 5
4.	B , 4
5.	A , 3
6.	I , 3
7.	J , 3
8.	L , 75
9.	F , 2
10.	G , 4
11.	D , 20