Completing and Matching Volume Equations Name:

**Match each problem with the equation that could represent it. Answer with the missing term and letter.**

**Ex)** 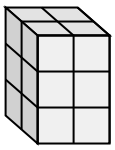

**1)** 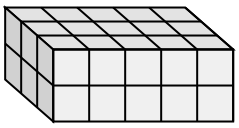

**2)** 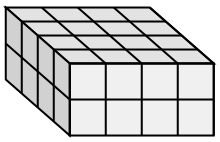

**3)** 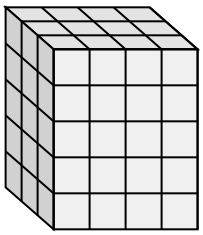

**4)** 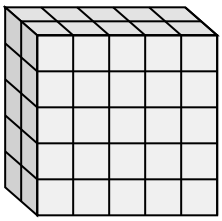

**5)** 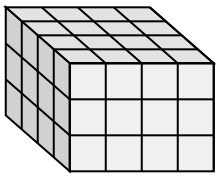

**6)** 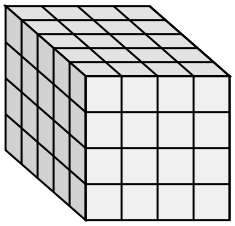

**7)** 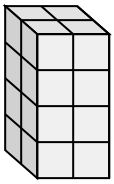

**8)** 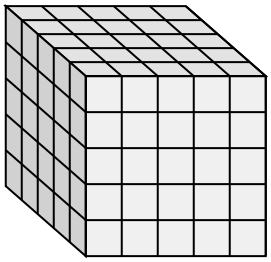

**9)** 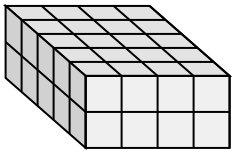

**10)** 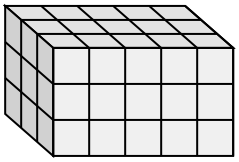

**11)** 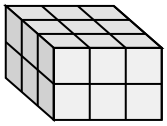

**A.** ___ × 4 × 3 = 48

**B.** ___ × 5 × 5 = 125

**C.** ___ × 5 × 3 = 45

**D.** 2 × 2 × 3 = ___

**E.** 3 × ___ × 2 = 18

**F.** 3 × ___ × 2 = 30

**G.** 2 × ___ × 4 = 16

**H.** 2 × 5 × ___ = 50

**I.** 4 × 4 × ___ = 32

**J.** ___ × 4 × 2 = 40

**K.** 3 × 4 × ___ = 60

**L.** ___ × 4 × 4 = 80

**Answers**

Ex. D , 12

1. _____

2. _____

3. _____

4. _____

5. _____

6. _____

7. _____

8. _____

9. _____

10. _____

11. _____



| | | | | | | | | | | |
|---|---|---|---|---|---|---|---|---|---|---|
| 1-10 | 91 | 82 | 73 | 64 | 55 | 45 | 36 | 27 | 18 | 9 |
| 11 | 0 | | | | | | | | | |

Completing and Matching Volume Equations Name: **Answer Key**

**Match each problem with the equation that could represent it. Answer with the missing term and letter.**

**Ex)** 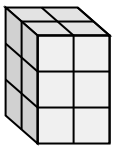

**1)** 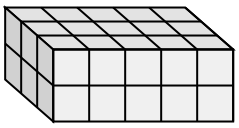

**2)** 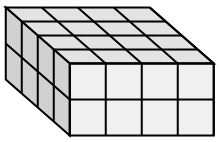

**3)** 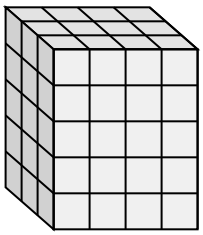

**4)** 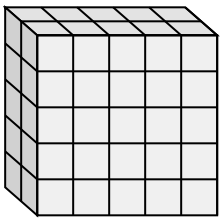

**5)** 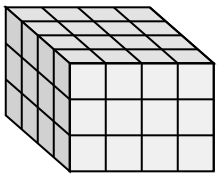

**6)** 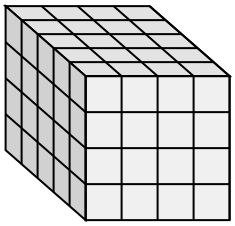

**7)** 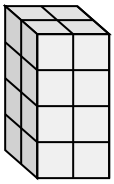

**8)** 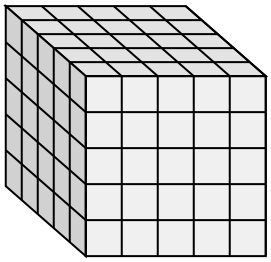

**9)** 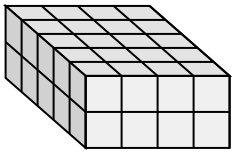

**10)** 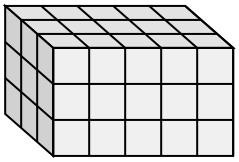

**11)** 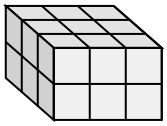

**A.** ___ × 4 × 3 = 48

**B.** ___ × 5 × 5 = 125

**C.** ___ × 5 × 3 = 45

**D.** 2 × 2 × 3 = ___

**E.** 3 × ___ × 2 = 18

**F.** 3 × ___ × 2 = 30

**G.** 2 × ___ × 4 = 16

**H.** 2 × 5 × ___ = 50

**I.** 4 × 4 × ___ = 32

**J.** ___ × 4 × 2 = 40

**K.** 3 × 4 × ___ = 60

**L.** ___ × 4 × 4 = 80

**Answers**

Ex. **D , 12**

1. **F , 5**
2. **I , 2**
3. **K , 5**
4. **H , 5**
5. **A , 4**
6. **L , 5**
7. **G , 2**
8. **B , 5**
9. **J , 5**
10. **C , 3**
11. **E , 3**



| | | | | | | | | | | |
|---|---|---|---|---|---|---|---|---|---|---|
| 1-10 | 91 | 82 | 73 | 64 | 55 | 45 | 36 | 27 | 18 | 9 |
| 11 | 0 | | | | | | | | | |