Completing and Matching Volume Equations

Name:

Match each problem with the equation that could represent it. Answer with the missing term and letter.

Ex) 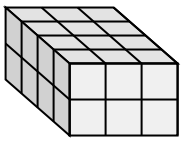

1) 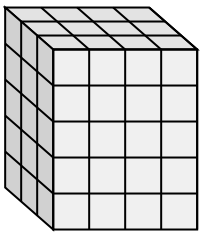

2) 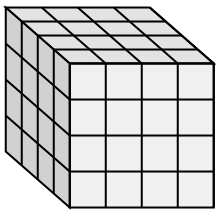

3) 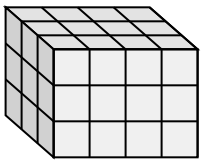

4) 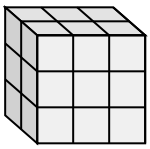

5) 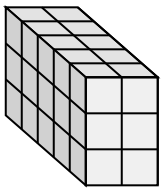

6) 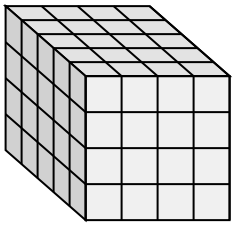

7) 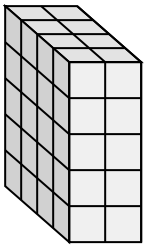

8) 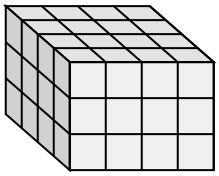

9) 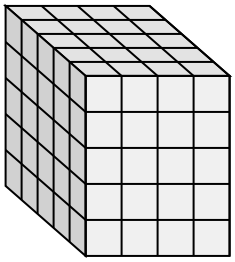

10) 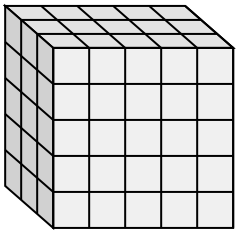

11) 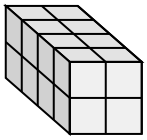

A. 4 × 4 × ___ = 48

B. 3 × 4 × 5 = ___

C. 4 × 2 × 2 = ___

D. 5 × 4 × ___ = 100

E. ___ × 2 × 5 = 40

F. 5 × 2 × ___ = 30

G. 3 × 4 × ___ = 36

H. 2 × 3 × ___ = 18

I. 5 × ___ × 4 = 80

J. ___ × 3 × 2 = 24

K. 4 × ___ × 4 = 64

L. ___ × 5 × 5 = 75

Answers

Ex. J , 4

1. _____
2. _____
3. _____
4. _____
5. _____
6. _____
7. _____
8. _____
9. _____
10. _____
11. _____

1-10	91	82	73	64	55	45	36	27	18	9
11	0									

Completing and Matching Volume Equations Name: **Answer Key**

Match each problem with the equation that could represent it. Answer with the missing term and letter.

Ex) 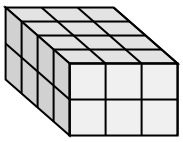

1) 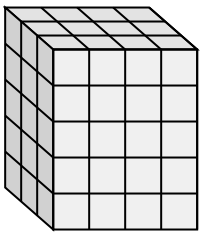

2) 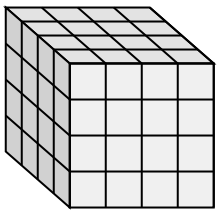

3) 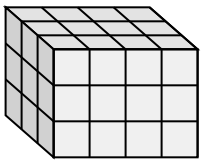

4) 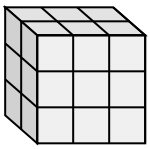

5) 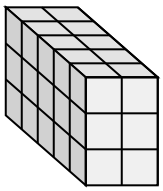

6) 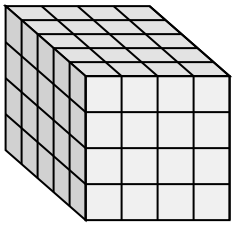

7) 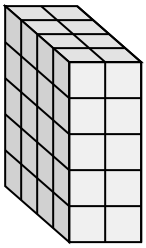

8) 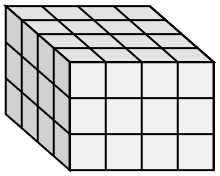

9) 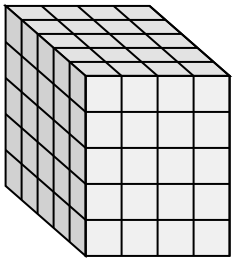

10) 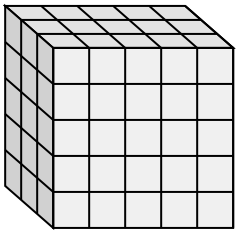

11) 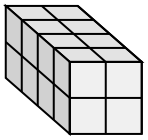

A. 4 × 4 × ___ = 48

B. 3 × 4 × 5 = ___

C. 4 × 2 × 2 = ___

D. 5 × 4 × ___ = 100

E. ___ × 2 × 5 = 40

F. 5 × 2 × ___ = 30

G. 3 × 4 × ___ = 36

H. 2 × 3 × ___ = 18

I. 5 × ___ × 4 = 80

J. ___ × 3 × 2 = 24

K. 4 × ___ × 4 = 64

L. ___ × 5 × 5 = 75

Answers

Ex.	J , 4
1.	B , 60
2.	K , 4
3.	G , 3
4.	H , 3
5.	F , 3
6.	I , 4
7.	E , 4
8.	A , 3
9.	D , 5
10.	L , 3
11.	C , 16

1-10	91	82	73	64	55	45	36	27	18	9
11	0									