Finding Angles within Shapes

Name:

Count the number of Acute, Obtuse and Right angles inside each shape.

Ex)

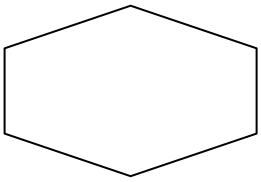

1)

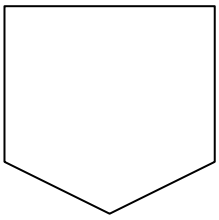

2)

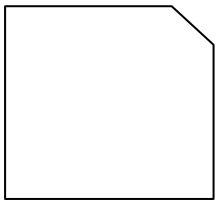

3)

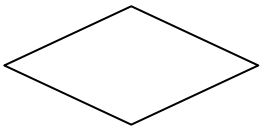

4)

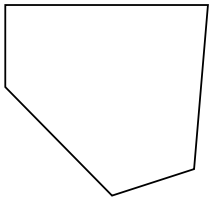

5)

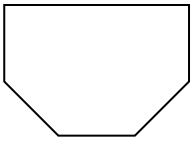

6)

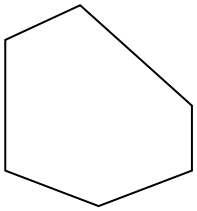

7)

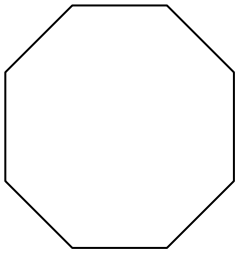

8)

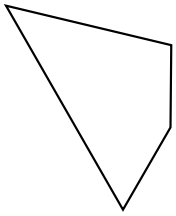

9)

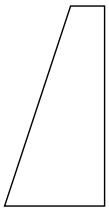

10)



11)

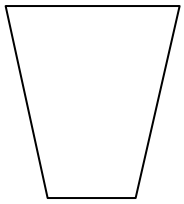

Answers

Ex.	0	6	0
1.			
2.			
3.			
4.			
5.			
6.			
7.			
8.			
9.			
10.			
11.			

Finding Angles within Shapes

Name: **Answer Key**

Count the number of Acute, Obtuse and Right angles inside each shape.

Ex)

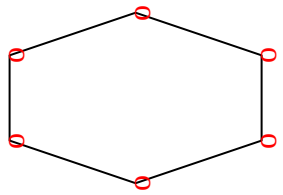

1)

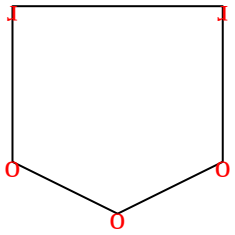

2)

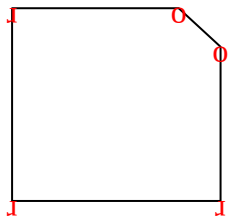

3)

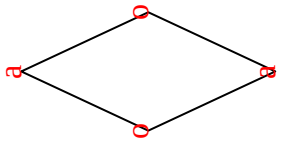

4)

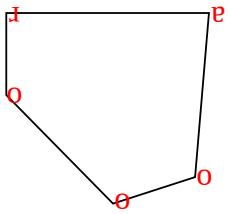

5)

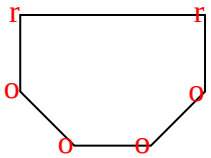

6)

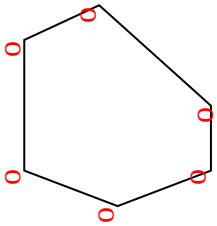

7)

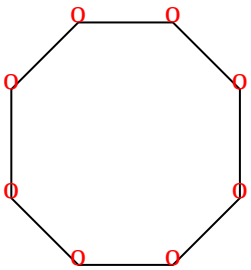

8)

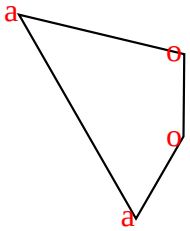

9)

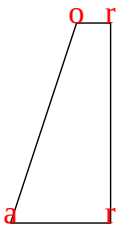

10)



11)

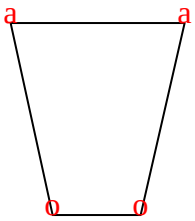

Answers

Ex.	0	6	0
1.	0	3	2
2.	0	2	3
3.	2	2	0
4.	1	3	1
5.	0	4	2
6.	0	6	0
7.	0	8	0
8.	2	2	0
9.	1	1	2
10.	0	0	4
11.	2	2	0