Function Machines (Add & Subtract) Name:

Determine the rule each function machine is using.

Ex)

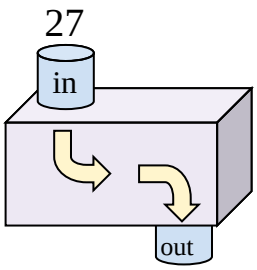

Add 13

1)

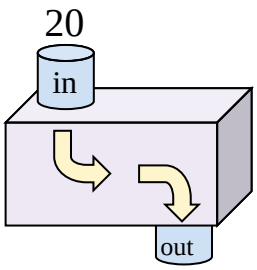

2)

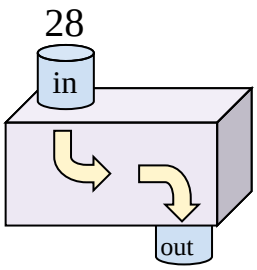

3)

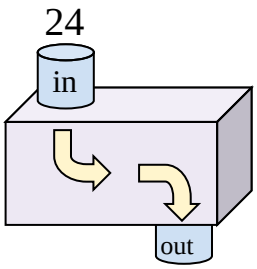

4)

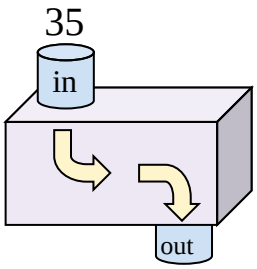

5)

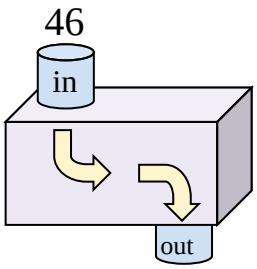

6)

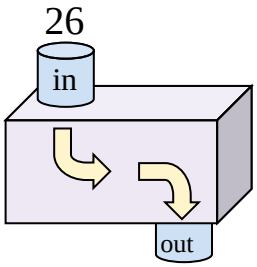

7)

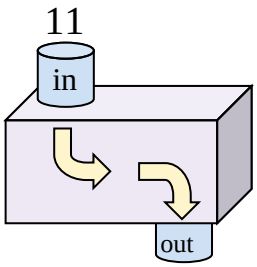

8)

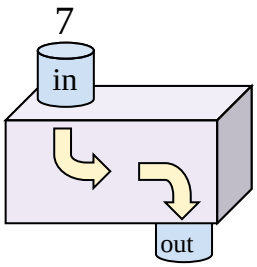

9)

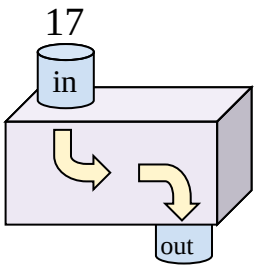

10)

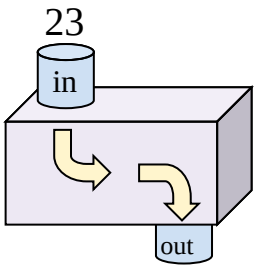

11)

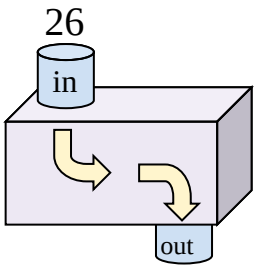

Answers

Ex. Add 13

1.

2.

3.

4.

5.

6.

7.

8.

9.

10.

11.

Function Machines (Add & Subtract) Name: **Answer Key**

Determine the rule each function machine is using.

Ex)

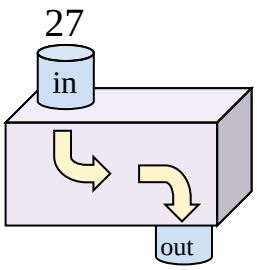

Add 13

1)

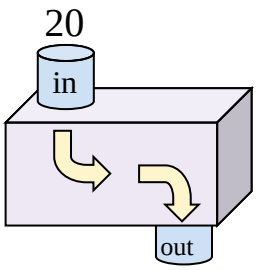

Add 9

2)

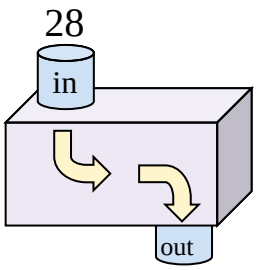

Subtract 19

3)

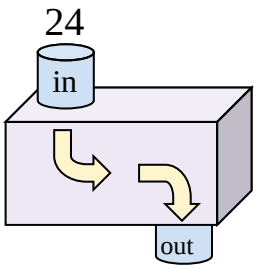

Add 9

4)

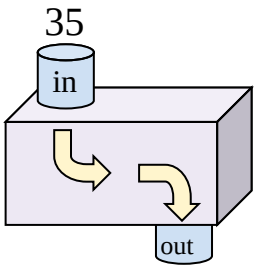

Subtract 7

5)

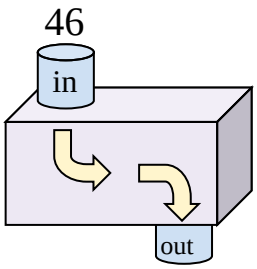

Subtract 19

6)

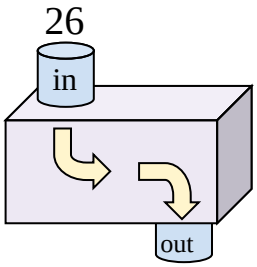

Subtract 14

7)

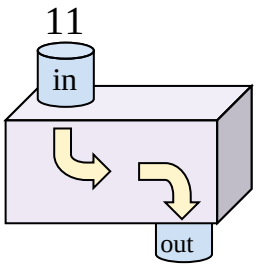

Add 10

8)

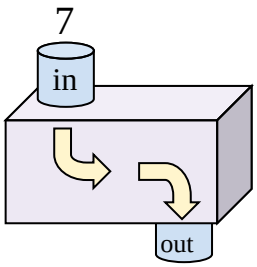

Add 10

9)

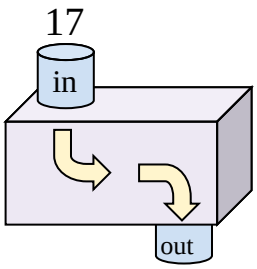

Subtract 9

10)

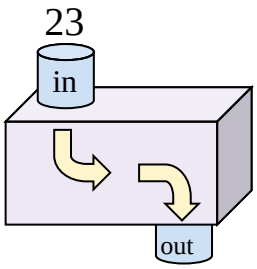

Subtract 6

11)

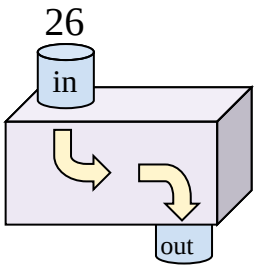

Subtract 17

Answers

Ex.	Add 13
1.	Add 9
2.	Subtract 19
3.	Add 9
4.	Subtract 7
5.	Subtract 19
6.	Subtract 14
7.	Add 10
8.	Add 10
9.	Subtract 9
10.	Subtract 6
11.	Subtract 17