Measuring and Showing Data Name:

Measure each ITEM tip to tip then place your results in the line plot.

Ex)

1)

2) 

3)

4)

5)

6) 

7)

8)

9)

10)

11)

Line Plot							
$\frac{1}{4}$	$\frac{1}{2}$	$\frac{3}{4}$	1	$1\frac{1}{4}$	$1\frac{1}{2}$	$1\frac{3}{4}$	2

Answers

Ex. $\frac{1}{2}$

1. _____
2. _____
3. _____
4. _____
5. _____
6. _____
7. _____
8. _____
9. _____
10. _____
11. _____

1-10	91	82	73	64	55	45	36	27	18	9
11	0									

Measuring and Showing Data

Name: **Answer Key**

Measure each ITEM tip to tip then place your results in the line plot.

Ex)

1)

2) 

3)

4)

5)

6) 

7)

8)

9)

10)

11)

Line Plot

X		X	X	X			
X	X	X	X	X	X	X	X
¼	½	¾	1	1 ¼	1 ½	1 ¾	2

Answers

Ex.	½
1.	2
2.	1 ¼
3.	¾
4.	¼
5.	1 ½
6.	1 ¾
7.	1
8.	¾
9.	1
10.	1 ¼
11.	¼

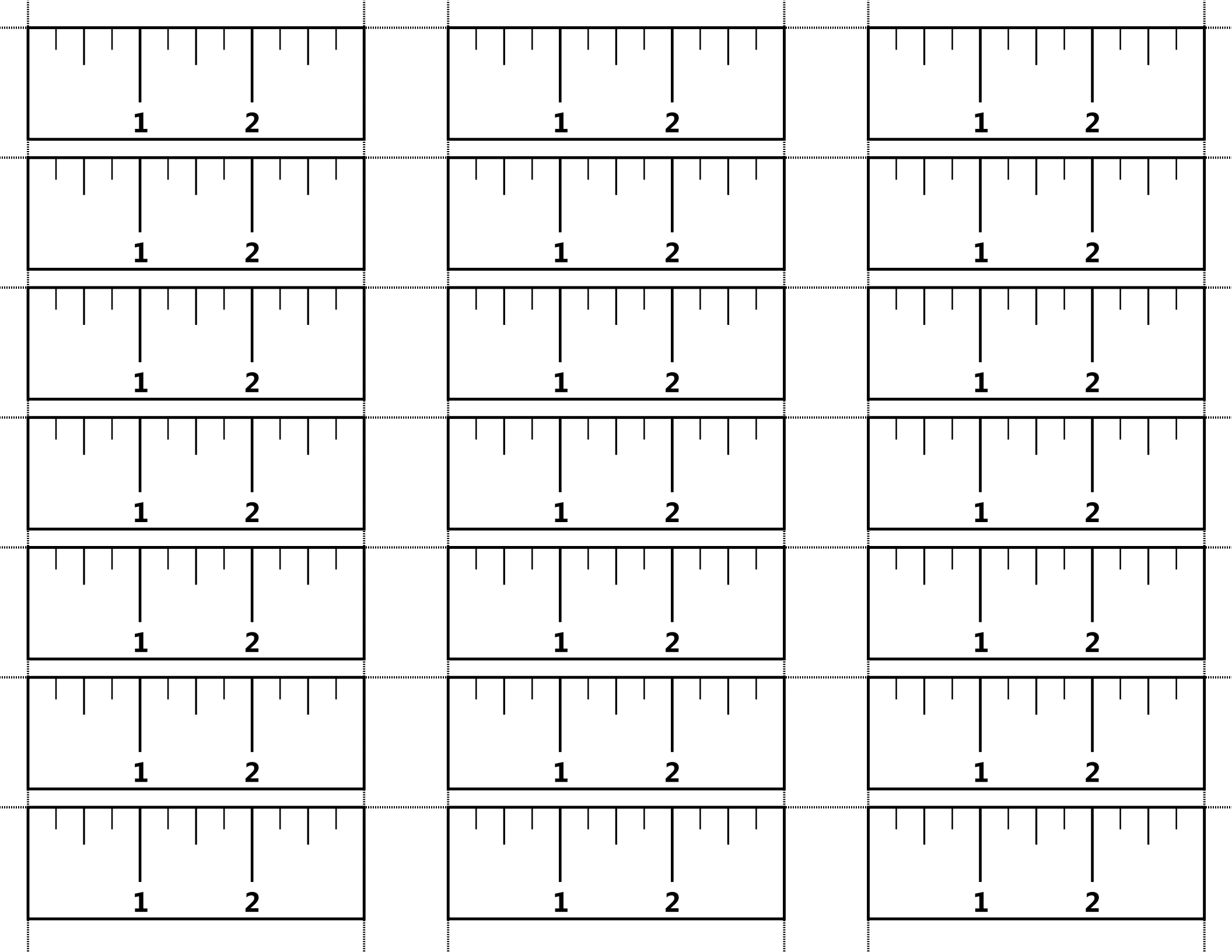
1
2