Multiplying Fractions (Visual)

Name:

Use the box provided to show a visual example of how to multiply two fractions.

Ex) $\frac{2}{8} \times \frac{2}{9} =$

1) $\frac{4}{7} \times \frac{1}{5} =$

2) $\frac{4}{6} \times \frac{1}{2} =$

3) $\frac{3}{4} \times \frac{1}{6} =$

4) $\frac{3}{9} \times \frac{4}{5} =$

5) $\frac{3}{6} \times \frac{5}{7} =$

6) $\frac{1}{3} \times \frac{2}{3} =$

7) $\frac{3}{5} \times \frac{5}{9} =$

8) $\frac{3}{7} \times \frac{7}{8} =$

9) $\frac{2}{5} \times \frac{3}{7} =$

10) $\frac{1}{2} \times \frac{6}{8} =$

11) $\frac{3}{5} \times \frac{2}{4} =$

Answers

Ex. $\frac{4}{72}$

1. _____
2. _____
3. _____
4. _____
5. _____
6. _____
7. _____
8. _____
9. _____
10. _____
11. _____

1-10	91	82	73	64	55	45	36	27	18	9
11	0									

Multiplying Fractions (Visual) Name: **Answer Key**

Use the box provided to show a visual example of how to multiply two fractions.

Ex) $\frac{2}{8} \times \frac{2}{9} =$

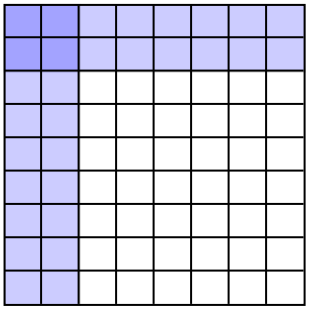

1) $\frac{4}{7} \times \frac{1}{5} =$

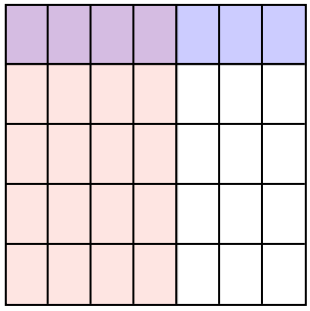

2) $\frac{4}{6} \times \frac{1}{2} =$

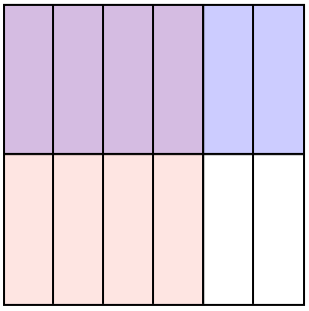

3) $\frac{3}{4} \times \frac{1}{6} =$

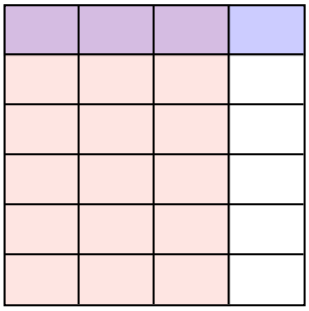

4) $\frac{3}{9} \times \frac{4}{5} =$

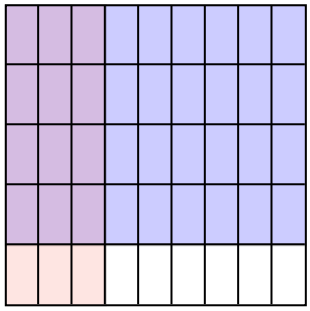

5) $\frac{3}{6} \times \frac{5}{7} =$



6) $\frac{1}{3} \times \frac{2}{3} =$

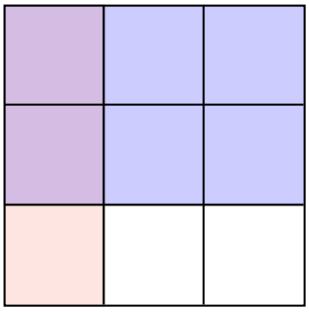

7) $\frac{3}{5} \times \frac{5}{9} =$

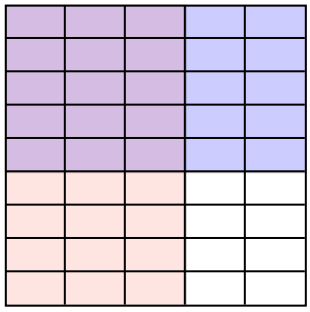

8) $\frac{3}{7} \times \frac{7}{8} =$

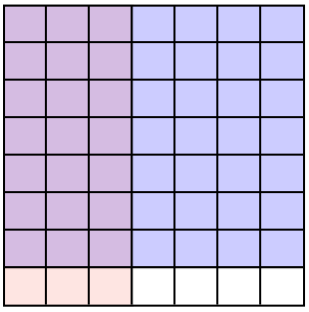

9) $\frac{2}{5} \times \frac{3}{7} =$

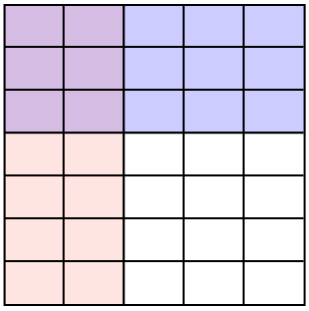

10) $\frac{1}{2} \times \frac{6}{8} =$

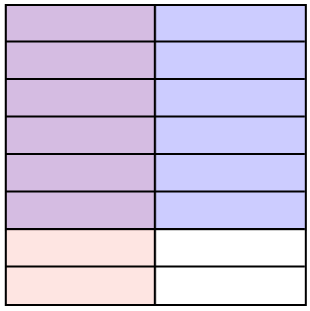

11) $\frac{3}{5} \times \frac{2}{4} =$



Answers

Ex. $\frac{4}{72}$

1. $\frac{4}{35}$
2. $\frac{4}{12}$
3. $\frac{3}{24}$
4. $\frac{12}{45}$
5. $\frac{15}{42}$
6. $\frac{2}{9}$
7. $\frac{15}{45}$
8. $\frac{21}{56}$
9. $\frac{6}{35}$
10. $\frac{6}{16}$
11. $\frac{6}{20}$

1-10	91	82	73	64	55	45	36	27	18	9
11	0									