Fraction Quantity Relative to Whole

Name:

Solve each problem.

Ex) Express the triangles as a fraction of the entire set.

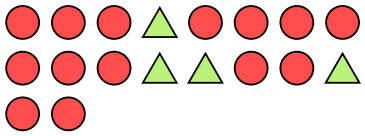

1) Express the moons as a fraction of the entire set.



2) Express the circles as a fraction of the entire set.

3) Express the squares as a fraction of the entire set.

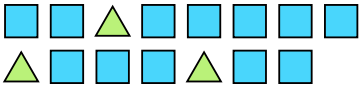

4) Express the triangles as a fraction of the entire set.

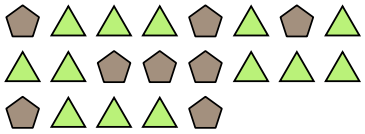

5) Express the triangles as a fraction of the entire set.

6) Express the moons as a fraction of the entire set.

7) Express the circles as a fraction of the entire set.



8) Express the moons as a fraction of the entire set.

9) Express the stars as a fraction of the entire set.

10) Express the circles as a fraction of the entire set.



11) Express the pentagons as a fraction of the entire set.

Answers

Ex. 4/18

1. _____
2. _____
3. _____
4. _____
5. _____
6. _____
7. _____
8. _____
9. _____
10. _____
11. _____

1-10	91	82	73	64	55	45	36	27	18	9
11	0									

Fraction Quantity Relative to Whole

Name: **Answer Key**

Solve each problem.

Ex) Express the triangles as a fraction of the entire set.

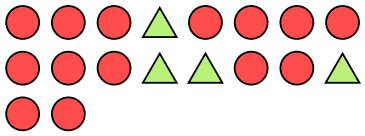

1) Express the moons as a fraction of the entire set.



2) Express the circles as a fraction of the entire set.

3) Express the squares as a fraction of the entire set.

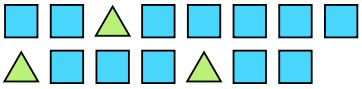

4) Express the triangles as a fraction of the entire set.

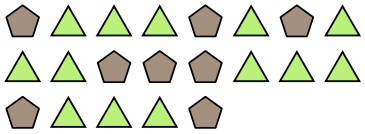

5) Express the triangles as a fraction of the entire set.

6) Express the moons as a fraction of the entire set.

7) Express the circles as a fraction of the entire set.



8) Express the moons as a fraction of the entire set.

9) Express the stars as a fraction of the entire set.

10) Express the circles as a fraction of the entire set.



11) Express the pentagons as a fraction of the entire set.

Answers

Ex.	4/18
1.	15/23
2.	9/16
3.	12/15
4.	13/21
5.	4/14
6.	5/9
7.	11/23
8.	7/12
9.	6/19
10.	8/23
11.	2/5

1-10	91	82	73	64	55	45	36	27	18	9
11	0									